EXAMEN FINAL DE MATEMÁTICA

Colegio Blas Pascal

NOMBRE Y APELLIDO: _____

1. COLOCA DENTRO DEL PARÉNTESIS EL NÚMERO QUE LE CORRESPONDE

1)

( ) recta

2)

( ) rayo

3)

( ) punto

4)

( ) plano

2. ESCRIBE EL NOMBRE DE LAS RECTAS SEGÚN SU CLASE *(PARALELA, PERPENDICULAR U OBLICUA)*

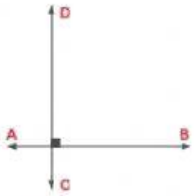

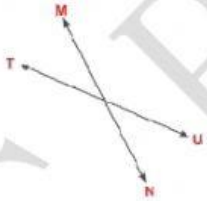



3. COMPLETA EN ESPACIOS LAS PARTES DE UN ÁNGULO.

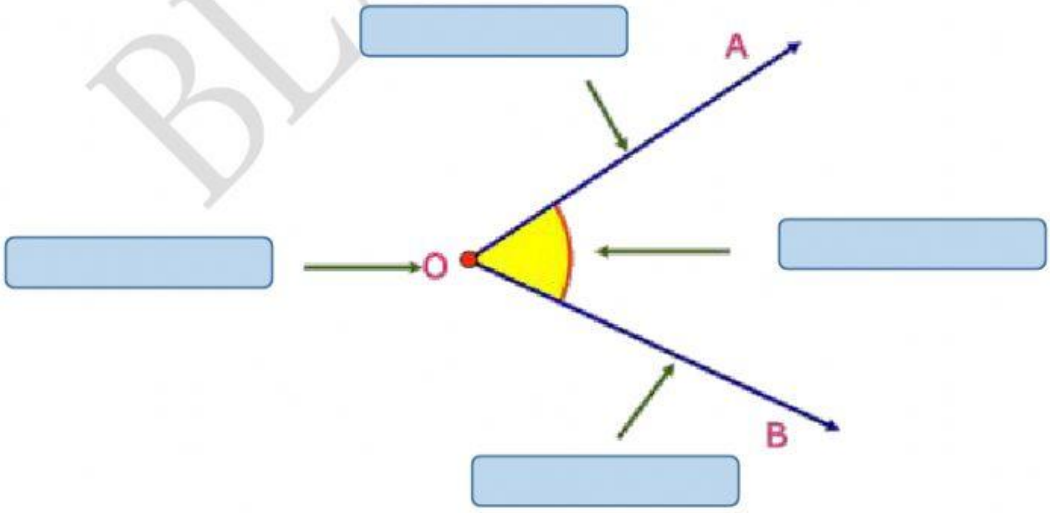

BLAS PASCAL

LIVEWORKSHEETS

4. ESCRIBE, A QUÉ CLASE DE ÁNGULO CORRESPONDEN SEGÚN SU MEDIDA.

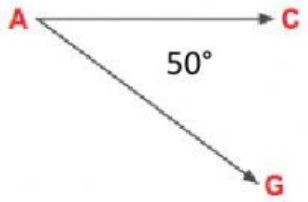

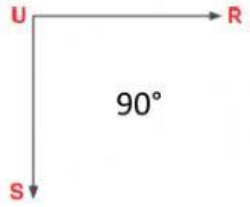

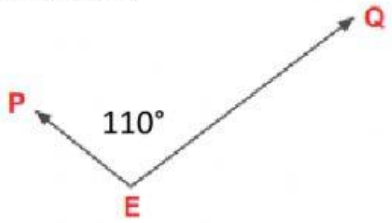

5. SELECCIONA EL NOMBRE DE CADA TRIÁNGULO SEGÚN LA MEDIDA DE SUS LADOS.

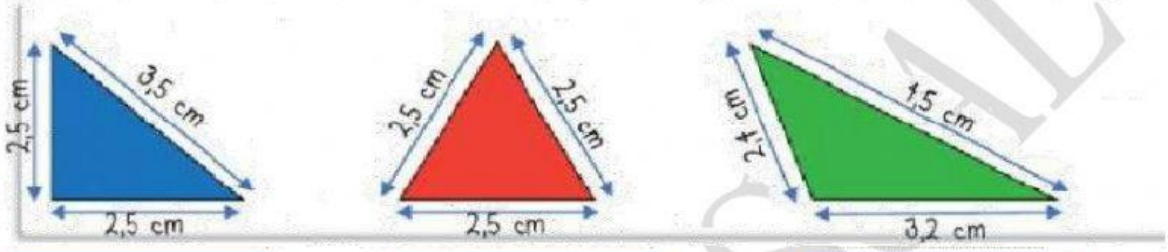

6. CALCULA EL ÁREA DE LOS SIGUIENTES TRIÁNGULOS:

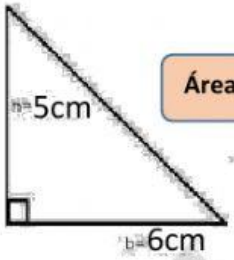

Área =

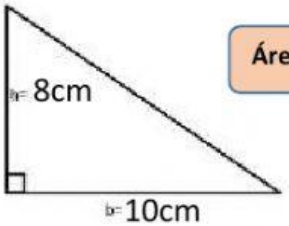

Área =

7. COMPLETA EL CUADRO.

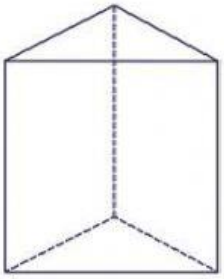

Bases	:
Vértices:	
Aristas	:
Caras	:

BLAS PASCAL

LIVEWORKSHEETS