LES NOTES MUSICALS

Escriu el nom de les notes musicals següents:



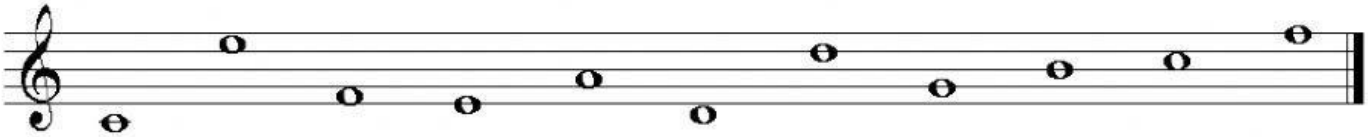



Relaciona la figura musical amb el seu nom:

NEGRA
RODONA
SEMICORXERA
BLANCA
CORXERA

Com es diuen els següents silencis?







Omple el requadre amb la durada de le figures i silencis musicals:

	Rodona	Blanca	Negra	Corxera	Semicorxera
Figures	𝅝	𝅗𝅥	𝅘𝅥	𝅘𝅥𝅮	𝅘𝅥𝅯
Pauses	𝄻	𝄼	𝄽	𝄾	𝄿
Durada					

Observa l'exemple i suma les pulsacions:

	+		+		+		+		=	6
	+		+		+		+		=	
	+		+		+		+		=	
	+		+		+		+		=	
	+		+		+		+		=	

4	8	7	8.5

Quin és el resultat de sumar aquestes figures i silencis?