MATHS SEMESTER REVIEW PART II

3D SHAPES, AREA, FRACTIONS, MULTIPLICATION, MEASURING, PERIMETER

LIVEWORKSHEETS

COMPLETE THE MISSING NUMBERS IN THIS FACT FAMILY!

REMEMBER, EACH SUM HAS TO INCLUDE THREE NUMBERS, 4, 6 AND 24

4x6 =24

x =24

= 4 x 6

24 = x

24 ÷ 4 =

24 ÷ = 4

4 = 24 ÷

6 = 24 ÷

4		12			24		32	36	
44	48		56	60		68	72		80

	12		24	30		42		54	
66	72		84	90		102	108	114	

LIVEWORKSHEETS

TIMES TABLES

Write in the missing numbers.

2		6		10			16	18	20
3	6	9		15		21	24		30

4			16	20		28		36	
5		15			30		40		50

6		18	24		36		48		60
7		21	28	35			56		70

8		24		40	48		64	72	
9			36	45		63		81	90

Put an X next to the multiples of 5x, 10x and.

65		20		8		90		38	
30		100		91		50		12	

What is the fifth multiple of 8?

What is the second multiple of 2?

What is the seventh multiple of 4?

What is the eighth multiple of 5?

LIVEWORKSHEETS

TIMES TABLES

Write in the missing numbers.

X	2		8
2	4	8	16
	8	16	
8	16	32	64

When we times by 10, we just add 0 to the number!

LIVEWORKSHEETS

Cube Cone Sphere Cylinder

Triangular prism Square-based pyramid



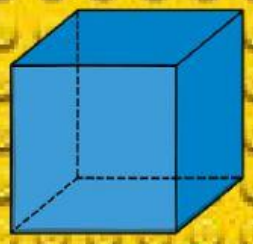

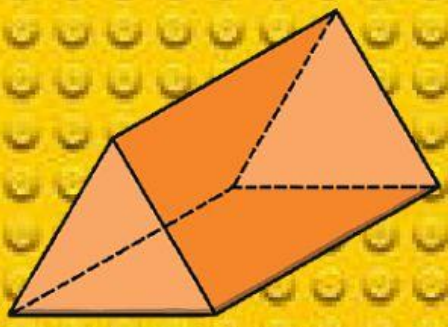



LIVEWORKSHEETS

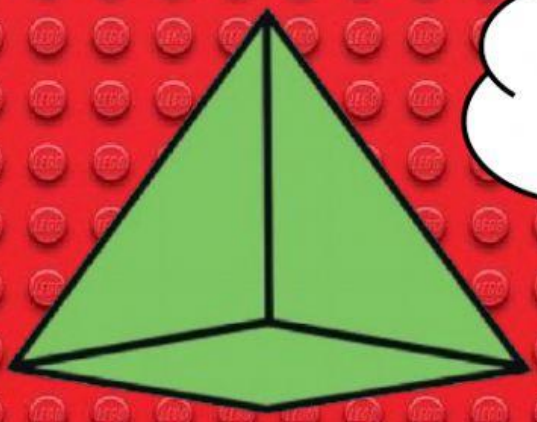

HOW MANY VERTICES, EDGES AND FACES DOES EACH SHAPE HAVE?

VERTICES =

EDGES =

FACES =

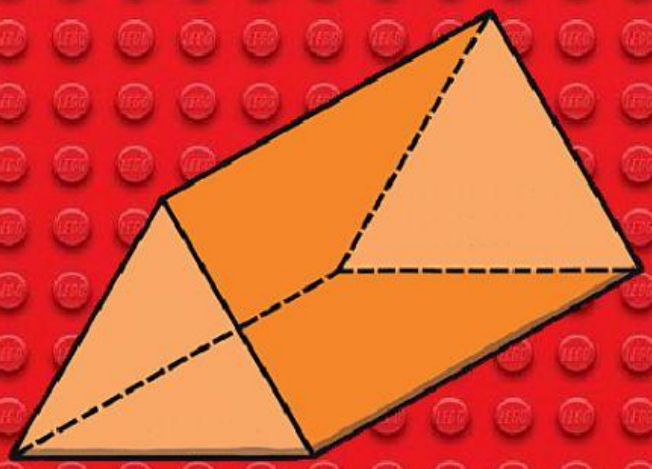



VERTICES =

EDGES =

FACES =

VERTICES =

EDGES =

FACES =

LIVEWORKSHEETS

PERIMETER

Find the perimeter of each shape

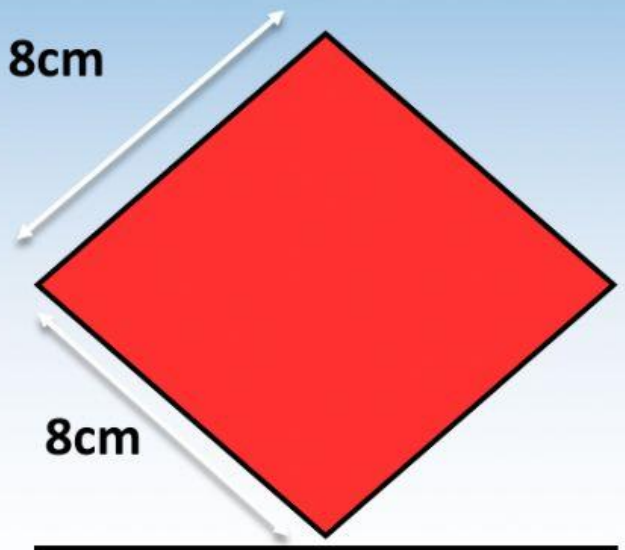

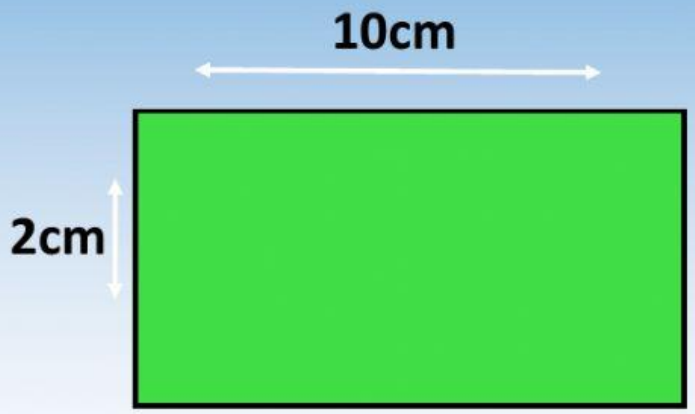

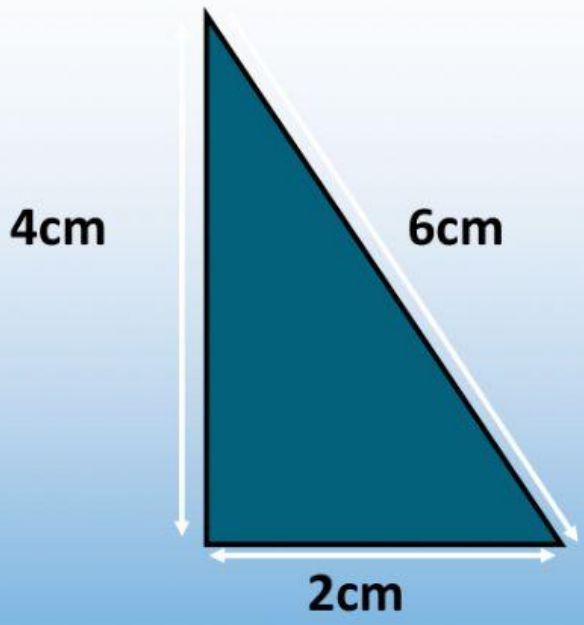

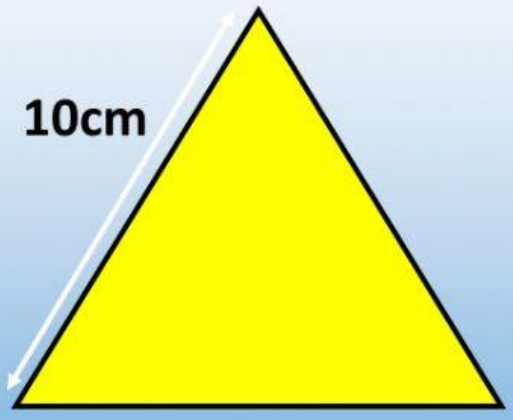

LIVEWORKSHEETS

AREA

Find the area of each irregular shape. Remember to count the half squares. Each square is 1cm.

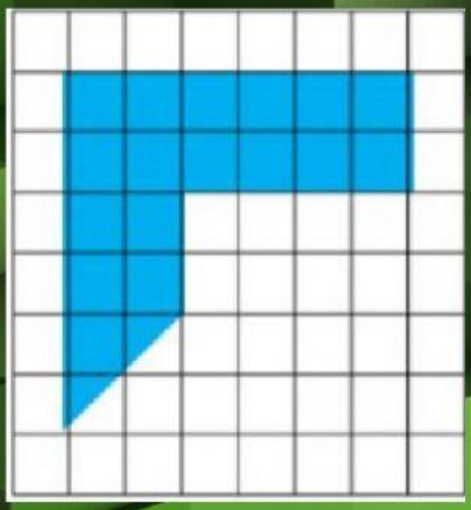

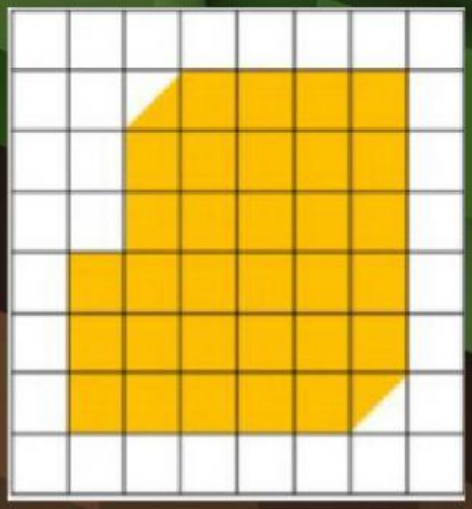

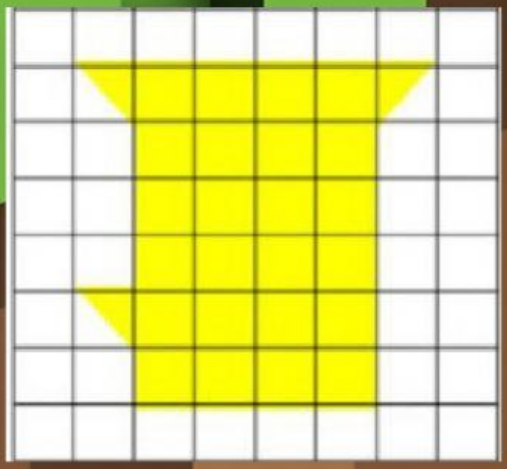

LIVEWORKSHEETS

EQUIVALENT FRACTIONS

Write the fraction

1/2

2x1 =

2x2 =

2/4

2x2 =

2x4 =

1/5

2x1=

2x5 =

3/4

3x3 =

3x4=

LIVEWORKSHEETS