DL DAV Model School

ND Block , Pitampura, Delhi- 34

CAMBRIDGE International Examinations

Cambridge International School

13.12.21 **Maths worksheet**

Q1. Which place value shows 45 X 10 ?

a) 45 b) 405 c) 450 d) 445

Q2. Write the weight of the following objects.

1.

_____ g

2.



_____ kg

Q3. Round each number to the nearest 100.

a) 660 = _____ b) 413 = _____ c) 187 = _____

Q4. Write the rule for each counting pattern.

a) 410 , 420 , 430 , 440 , 450 - Rule is _____

b) 60 , 58 , 56 , 54 , 52 - Rule is _____

LIVEWORKSHEETS

Q5. Look at the class timetable.

Class timetable	
8:30 - 9:00	English
9:00 - 9:30	Hindi
9:30 - 10:00	Maths
10:00 - 10:30	Break

a) At what time is the Maths class ? _____

b) What finishes at 10:30 ? _____

c) What lesson is at 9:00 ? _____

d) What is before Hindi ? _____

Q6. How much liquid is in each measuring cylinder ?

a)

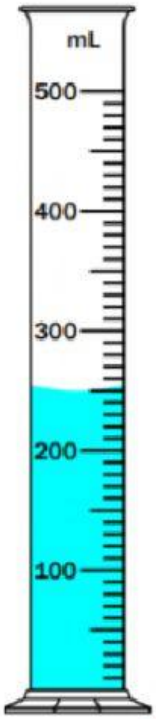

_____ ml

b)



_____ ml

LIVEWORKSHEETS

Q7. Choose the correct symbol =, < or > to complete these statements.

a) 135 ☐ 235

1. = 2. < 3. >

b) 500 ☐ 499

1. = 2. < 3. >

c) 420 ☐ 220

1. = 2. < 3. >

d) 660 ☐ 660

1. = 2. < 3. >

LIVEWORKSHEETS