Electricity Unit Test

Label the diagram. Use the word bank

power pole | pylon | power station | transformers

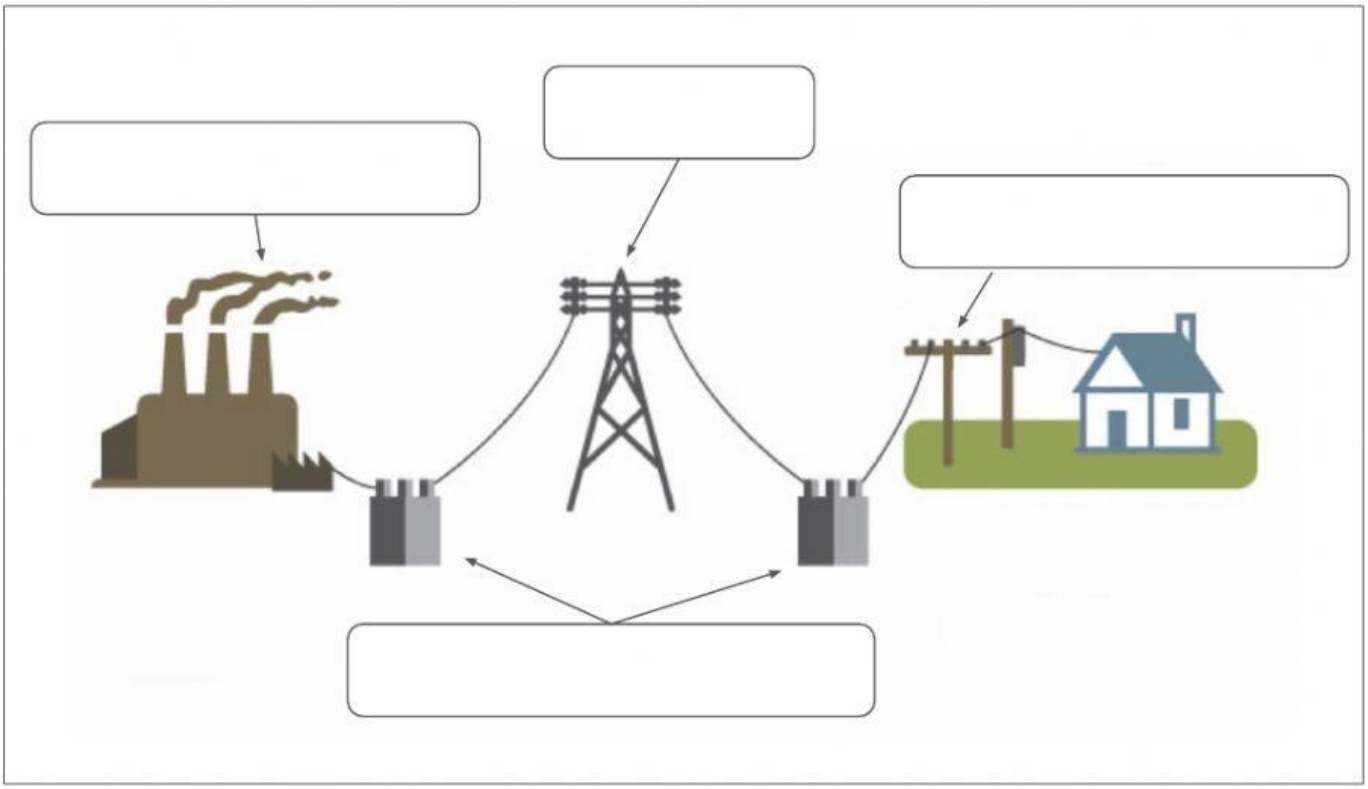

Choose the correct type of energy source.

natural gas	running water	wind
Renewable	Renewable	Renewable
Non-renewable	Non-renewable	Non-renewable

oil	coal	sunlight
Renewable	Renewable	Renewable
Non-renewable	Non-renewable	Non-renewable

LIVEWORKSHEETS

Label the power stations. Use the word bank.

wind farm solar hydroelectric fossil-fueled geothermal





Circle the best answer to complete the sentence.

Solar thermal power stations use energy from **sunlight / running water**

Hydroelectric power stations use energy from **coal / running water**

Wind farms use energy from **wind / sunlight**

LIVEWORKSHEETS

Choose 'true' or 'false' from the statements below.

You should not overload a plug socket.

true

false

It is okay to use devices with broken wires.

true

false

Never touch electrical appliances with wet hands.

true

false

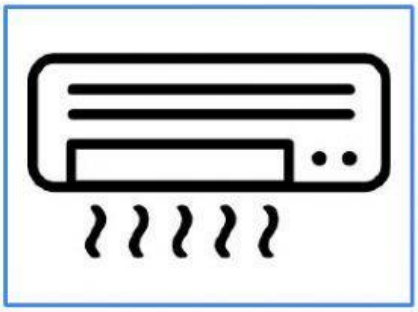

Use air conditioning all day to save or conserve energy.

true

false

It is okay to keep the fridge door open.

true

false

You should wash a full load and use cold water to save energy.

true

false

LIVEWORKSHEETS