PHIẾU TOÁN TUẦN 13 SỐ 3

Bài 1: Điền > ; < ; = ?

7 – 2 ☐ 7 – 1	6 – 2 ☐ 9 – 5	3 + 6 ☐ 7 + 2
6 – 3 ☐ 4 – 1	8 – 3 ☐ 6 – 4	5 – 3 ☐ 8 – 4
8 – 1 ☐ 7 – 4	2 + 5 ☐ 5 + 3	2 + 8 ☐ 1 + 8

Bài 2: Điền số ?

3 = 7 – ☐	3 = 5 – ☐	7 = 2 + ☐
3 = ☐ – 3	4 = ☐ – 3	5 = ☐ – 1
6 = ☐ – 1	6 = ☐ – 2	4 = ☐ – 4

Bài 3: Viết phép tính thích hợp.

a)



☐☐☐☐☐

b)



☐☐☐☐☐

Bài 4: Hình bên có:



.....hình chữ nhật

LIVEWORKSHEETS