1. Name the shapes correctly

Circle | Rectangle | Square | Triangle

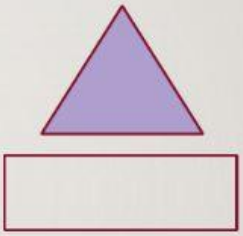

LIVEWORKSHEETS

2. Match the shapes correctly

Cylinder

Cone

Cube

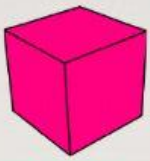

Pyramid

Sphere

LIVEWORKSHEETS

3. State the basic shape blocks used. Count every basic shape block.



| Basic shape blocks | Number |
|---|---|
| Cube | |
| Sphere | |
| Cylinder | |
| Cone | |
| Pyramid | |

LIVEWORKSHEETS

4. Observe the robot below and fill the blanks with the correct basic shapes.

Hi, my name is Shapy. The shape of my face is _____. There are two _____ on my face. I wear a hat which is a _____. My body is a _____ shape. My beautiful shoes are in the shapes of a _____. Each of my arm is a _____.



LIVEWORKSHEETS