BELAJAR MEMBUAT SOAL DI LIVE WORKSHEET
(MUATAN PELAJARAN MATEMATIKA)

Berikut ini gambar yang menunjukkan nilai pecahan $\frac{1}{2}$ adalah . . . .

(1)

(2)

(3)

(4)

a Gambar 1

b Gambar 2

c Gambar 3

d Gambar 4

LIVEWORKSHEETS

Setiap irisan kue pada gambar di samping bernilai pecahan ….

….

Ayo kita hitung nilai pecahan yang ada pada gambar 1, gambar 2, dan gambar 3 !





LIVEWORKSHEETS

Pecahan berikut yang menunjukkan nilai setengah adalah . . . .

$\frac{1}{4}$	$\frac{1}{1}$	$\frac{1}{2}$	$\frac{1}{3}$

Tariklah garis yang menghubungkan gambar dengan nilai pecahan yang sesuai !



$\frac{1}{3}$

$\frac{1}{4}$

$\frac{1}{2}$

$\frac{1}{6}$

LIVEWORKSHEETS

Tarik gambar berikut ke dalam kotak yang sesuai !

$\frac{1}{2}$	$\frac{1}{2}$	$\frac{1}{3}$	$\frac{1}{4}$

Sebutkan nilai pecahan yang ada pada gambar dengan cara menekan tombol rekam yang tersedia !

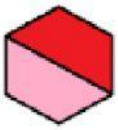
(1)


(2)

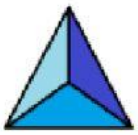
(3)

(4)

LIVEWORKSHEETS

8 Listening

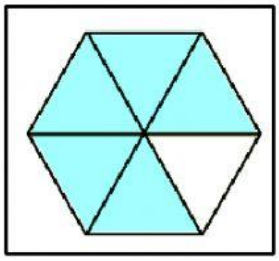

Benar | Salah

Benar | Salah

9 Word Search

A	B	S	C	D	T	E	G
C	B	A	R	D	I	H	I
S	E	T	E	N	G	A	H
M	D	U	A	T	A	Y	F
G	A	L	I	B	E	D	A
L	T	A	C	I	N	G	M

LIVEWORKSHEETS

LIVEWORKSHEETS