แบบฝึกทักษะที่ 3.1

เรื่อง ความเท่ากันทุกประการของรูปเรขาคณิต

จงเติมเครื่องหมาย "≅" หรือ "≇" ลงใน □ ที่กำหนดให้

1) 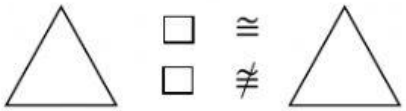
□ ≅
□ ≇

2) 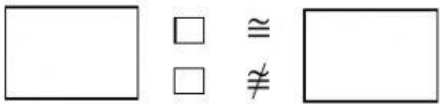
□ ≅
□ ≇

3) 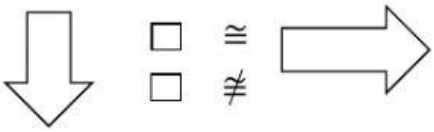
□ ≅
□ ≇

4)
□ ≅
□ ≇

5) 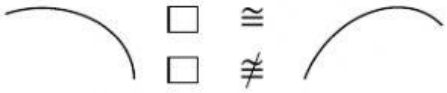
□ ≅
□ ≇

6) 
□ ≅
□ ≇

7) 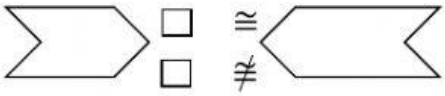
□ ≅
□ ≇

8) 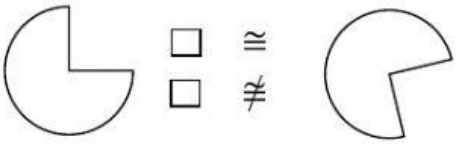
□ ≅
□ ≇

9) 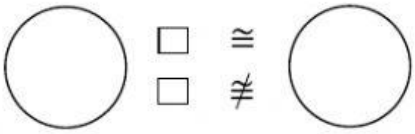
□ ≅
□ ≇

10) 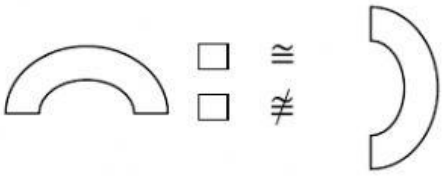
□ ≅
□ ≇

11) 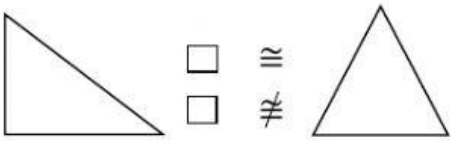
□ ≅
□ ≇

12) 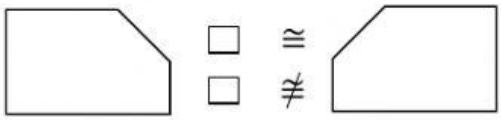
□ ≅
□ ≇

13) 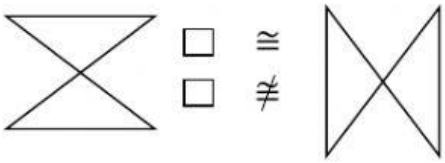
□ ≅
□ ≇

14) 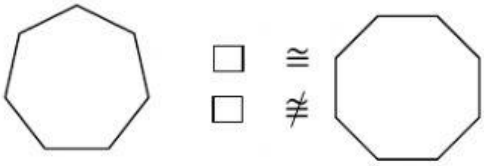
□ ≅
□ ≇

LIVEWORKSHEETS