Measure the objects. Answer the questions.



____ cm



____ cm

How much longer is the eraser than the sharpener?

□ ○ □ = □



____ cm



____ cm

How much longer is the marker than the crayon?

□ ○ □ = □

LIVEWORKSHEETS

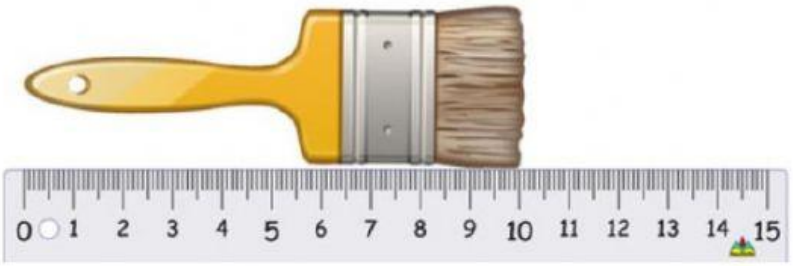

____ cm

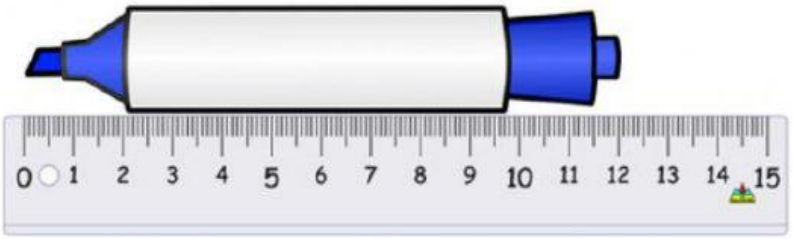

____ cm

How much shorter is the paintbrush than the marker?

☐ ○ ☐ = ☐



____ cm



____ cm

How much shorter us the sharpener than the crayon?

☐ ○ ☐ = ☐

LIVEWORKSHEETS