CHRISTMAS TEST

MENTAL

1. Complete the sequence of oranges sold in one week at Mr. Joe's Mini Mart

Monday	36
Tuesday	____
Wednesday	____
Thursday	27
Friday	24
Saturday	_____



2. What number comes between 67 and 69?____

3. Take 4 times 2 from 50____

4. You are skip counting in 5s. What number comes after 25?____

5. The numbers below are listed in a sequence of ascending or descending order with missing numbers. State the missing numbers for each group.

a.	10	20	___	___	50	____
b.	250	___	350	400	___	____
c.	___	1000	900	___	___	600

6. Write the next two numbers in the 100s sequence below

a.	2243	2343	____	____	2643
b.	3150	___	____	2850	2750

LIVEWORKSHEETS

7. Fill in the missing numbers skip counting in 1000s

a.	1235	____	____	4235	____	____
b.	7800	____	5800	____	____	____

8. Follow the pattern and select the correctly combined two numbers to complete the numbers in descending order.

370 340 310 280 250 ___ ___

Which combination best complete the pattern

(i) 230, 170 (ii) 190, 120
(ii) 220, 290 (iv) 220, 190

9. Solve and select the correct ***number*** below

7 + 9 + 12 = _____ x 4

a. 7 b. 8
b. 9 d. 10

10. What ***number*** must be added to 5 times 7 to make 100?_____

a. 75 b. 56
b. 65 d. 38

11. 146 + _____ = 308

12. I am thinking of a number. I double it and add One (1). The answer is 17.

What ***number*** am I thinking of?_____

a. 7
b. 8
c. 9
d. 10

LIVEWORKSHEETS

For items 13 to 16 below, use know formulas to calculate the missing ***Subtrahend***, ***Minuend, Difference*** or ***Total***

13. _____ + 29 = 47

14. 62 = 32 + _____

15. 35 = 7 + 9 + _____

16. 53 + 35 = _____



17. Rearrange the digits in the number **7491** to create the **largest** possible number

18. Rearrange the digits in the number **4265** to create the **smallest** possible number

19. Given the cube stacking below, state the ***number*** of cubes present. _____

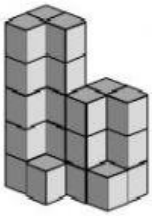

28	18	25	27	26
A	B	C	D	E

LIVEWORKSHEETS

20. How many triangles are in the picture?_____

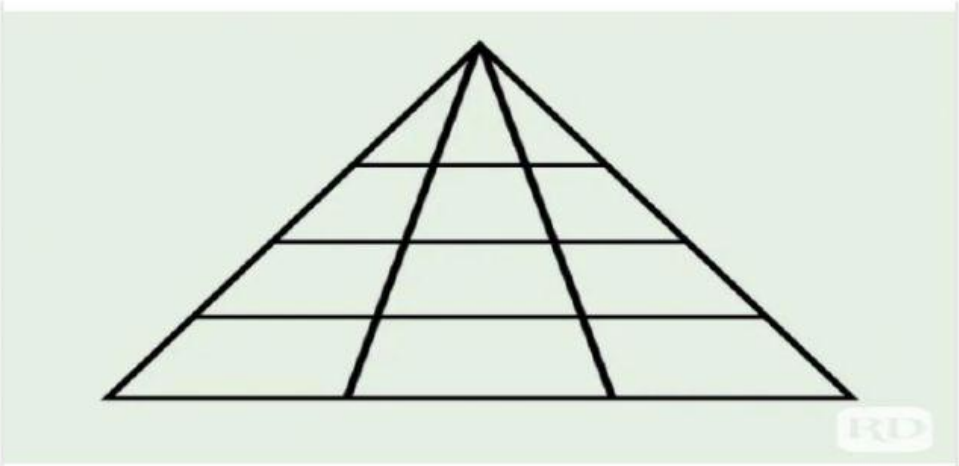

END OF TEST

LIVEWORKSHEETS