Menghitung Jumlah Hewan

Hitunglah jumlah hewan yang ada di bawah ini dengan tepat!



1 3 4



2 5 4



6 5 3



7 6 8

LIVEWORKSHEETS

6 3 2

8 7 4

6 5 7

9 4 8

LIVEWORKSHEETS

11 10 12

9 11 8

12 9 11

10 9 11

LIVEWORKSHEETS