2nd Monthly Chapter Test
MAPEH 1

Name:_____ **Date:**_____**Score:**_____

I. Choose the correct answer.

1. It is tune of a song.

Melody Noise Sound

2. The highness and lowness of tones or sound is called _____.

pitch Noise Silence

3. The following has a natural color except _____.

tree Flower cake

4. Circles, squares, triangle and rectangle are examples of _____ shapes.

Geometric Organic Natural

5. When movements are executed travelling around a given space these are called _____.

Position Stretching locomotor movement

II. Choose the picture that shows healthy habits. (6-10)

LIVEWORKSHEETS

III. Draw a line that connects the description in column A to the picture in column B.

Column A	Column B
11. Hopping	**a.**
12. Sliding	**b.**
13. Running	
14. Walking	**d.**
15. Galloping	**e.**

IV. Choose the things you use to keep yourself clean and tidy. (16-20)



LIVEWORKSHEETS

V. Draw a house using geometric shapes given below and put colors on it to make it more beautiful. (25-30) (Do it on your paper.)



"My help comes from the Lord, the Maker of heaven and earth"

Psalm 121:2

Prepared by:

Ms. Anna Lee V. Palaran

LIVEWORKSHEETS