Name: .....

Second Year Infants
End of Term Test
Mathematics

Write the WORD NAME next to each of the following numerals

20 -	12 -
11 -	5 -

Write the NUMERAL next to each of the following word name

seven -	nineteen -
six -	ten -
fifteen -	zero -

Select the **even** numbers

1	2	3	4	5	6	7	8	9	10

Select the **odd** numbers

1	2	3	4	5	6	7	8	9	10

Let's count in 2's – fill in the missing numbers

2		6		10			16		20

Let's count in 5's – fill in the missing numbers

	10	15		25			40		

Match the Ordinal numbers to its word name

1st	second
2nd	tenth
3rd	sixth
4th	ninth
5th	seventh
6th	fifth
7th	third
8th	first
9th	fourth
10th	Third

LIVEWORKSHEETS



The elephant is _____ than the boy.

The feather is _____ than the pencil.

The chair is _____ and the apple is _____.

Find the length of the following objects

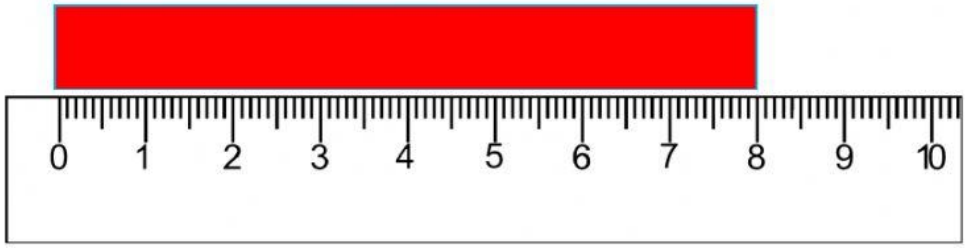

= _____cm

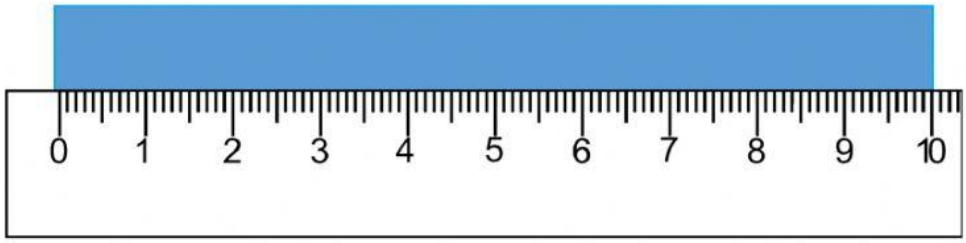

= _____cm

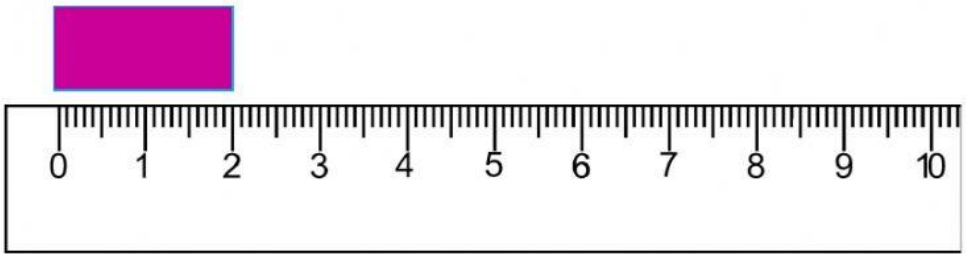

= _____cm

LIVEWORKSHEETS

Find the Height of the following.



The tree is ___ blocks in height

The car is ___ blocks in height

Write either **equal** or **unequal** below each scale

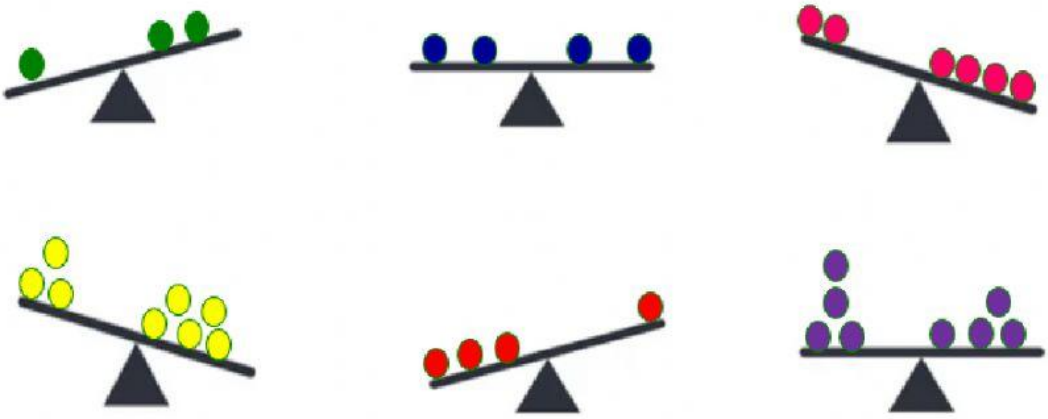

Find the area of the coloured part of the shapes below.

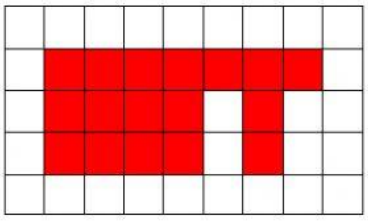

_____ **Square units**

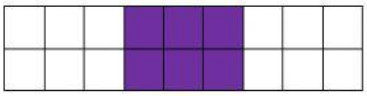

_____ **Square units**

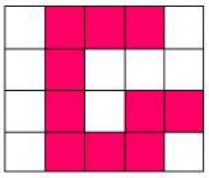

_____ **Square units**



_____ **Square units**

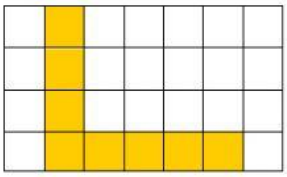

_____ **Square units**

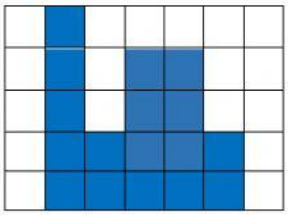

_____ **Square units**

LIVEWORKSHEETS

Count up on the number line to add

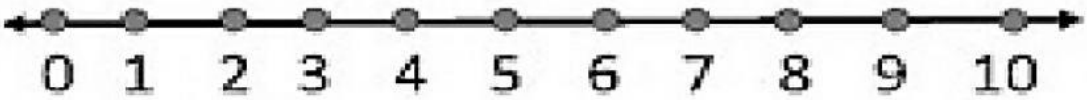

3 + 1 = ____ 9 + 1 = ____

1 + 6 = ____ 2 + 2 = ____

8	4	0	2
6	8	6	5
+ 1	+ 5	+ 0	+ 3
____	____	____	____

Instructions: Read each word problem. Then find the difference.

There are **4** frogs in the pond. Then **3** frogs hopped away. How many frogs are **left**?

[ ] − [ ] = [ ]

frogs

I had **8** cookies. My mom ate **5** cookies. How many cookies do I have **left**?

[ ] − [ ] = [ ]

cookies

Sally saw **7** fish. Then **5** fish swam away. How many fish were **left**?

[ ] − [ ] = [ ]



fish

LIVEWORKSHEETS

Write the **expanded form** of the numbers below.

23 = 20 + 3	55 = ___ + ___
17 = ___ + ___	89 = ___ + ___
96 = ___ + ___	42 = ___ + ___
74 = ___ + ___	68 = ___ + ___
31 = ___ + ___	26 = ___ + ___

Fill in the numbers to complete each addition sentence.

____ = 10 + 2	____ = 20 + 4
____ = 40 + 8	____ = 70 + 3
____ = 90 + 1	____ = 30 + 7
____ = 50 + 6	____ = 60 + 9

LIVEWORKSHEETS

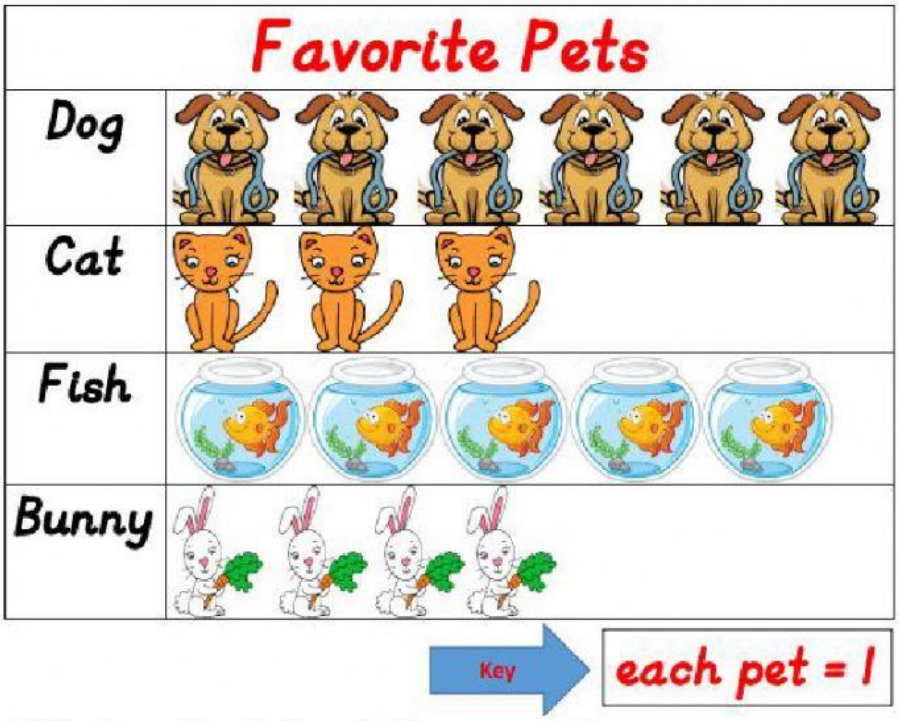

What is the title of the graph?

. How many dogs are there?

. How many cats are there?

. How many pets are there altogether?

. How many more dogs than cats are there?

. Which animal was liked the most?

End of test

LIVEWORKSHEETS