SEKOLAH KEBANGSAAN TABUAN HILIR
KAMPUNG TABUAN MELAYU 93450 KUCHING SARAWAK

PENTAKSIRAN SETARA STANDARD
TAHUN 4 (2021)
MUZIK
(1 JAM)

NAMA MURID :

KELAS :

JANGAN BUKA KERTAS SOALAN INI SEHINGGA DIBERITAHU

Arahan:

Jawab semua soalan di ruang yang telah disediakan.

LIVEWORKSHEETS

A. Pilih jawapan yang betul.

BALUK | BAR | GARISAN | RUANG | ULANGAN

GARIS BAR | GARIS PENAMAT | KLEF TREBEL



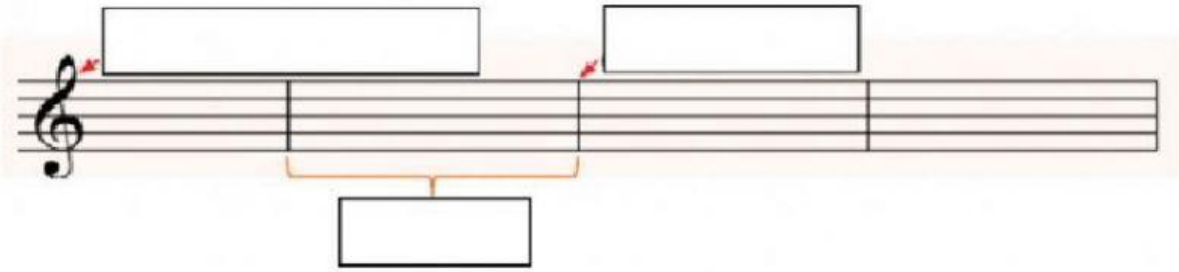

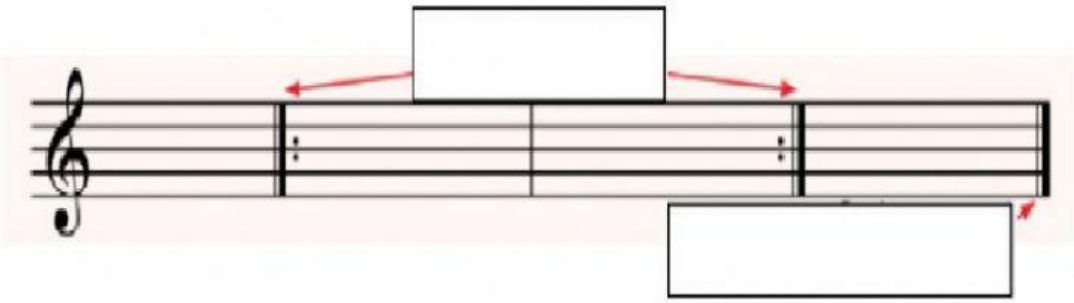

LIVEWORKSHEETS

B. Padankan not yang betul.

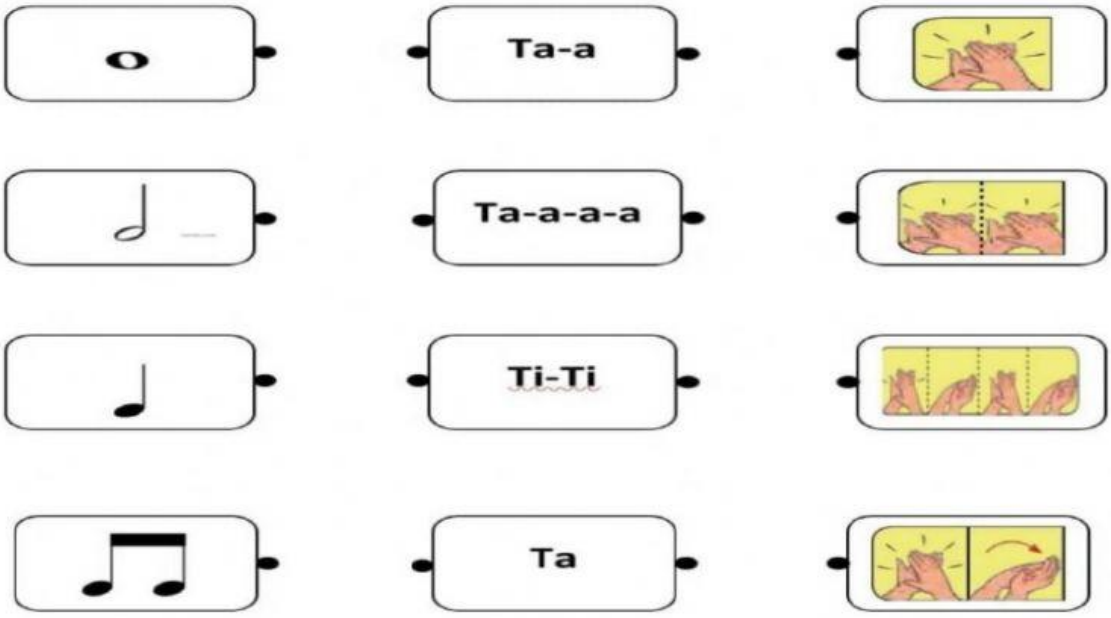

C. Namakan not di bawah. (G, A, D', B, C, G)

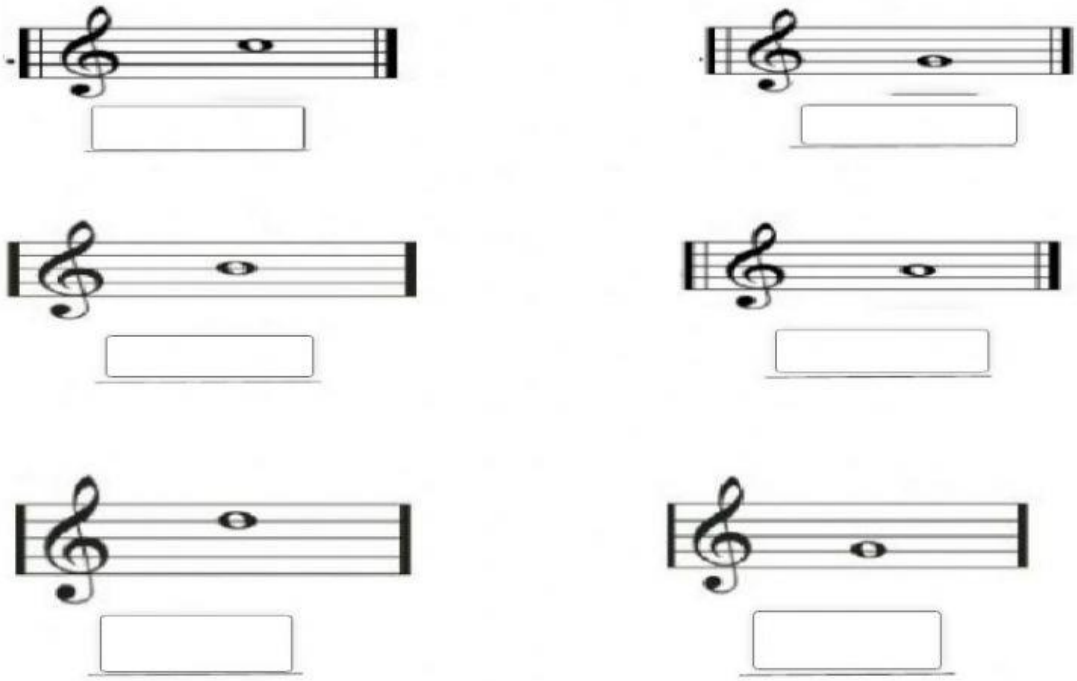

LIVEWORKSHEETS

D. Pilih tempo cepat atau lambat berdasarkan gambar.

CEPAT

LAMBAT

LIVEWORKSHEETS

E. Namakan alat muzik di bawah.

tamborin	Kayu tik tok	kastenet
marakas	simbal	kerincing

1. Padankan nama alatan yang betul bagi setiap gambar perkusi di bawah.

LIVEWORKSHEETS

E. Kira nilai not di bawah berdasarkan jadual yang diberi.



Jenis Not	Not	Tanda Rehat	Nilai
Semikuaver			¼
Kuaver			½
Krocet			1
Minit			2
Semibrif			4

LIVEWORKSHEETS

F. **Suaikan penjarian rekoder di bawah dengan betul.**

1.

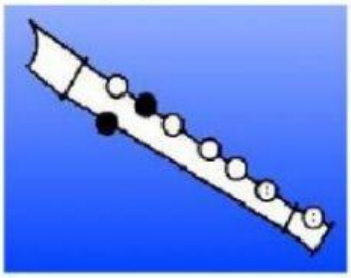

2.

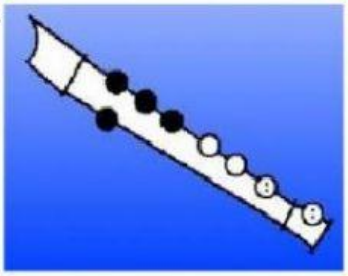

3.

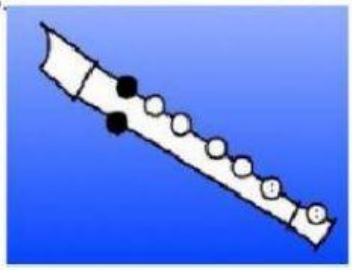

4

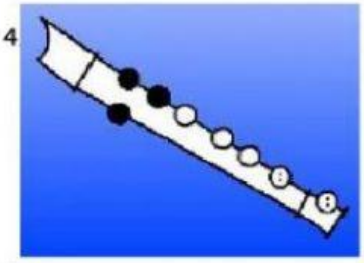

5.

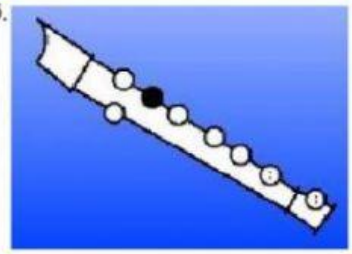

Not A

Not C'

Not D'

Not B

Not G

LIVEWORKSHEETS