PENILAIAN KETERAMPILAN
KELAS 2

Nama/nomor: _____ Kelas: _____

I. Pilihlah gambar bangun ruang yang sesuai, dengan cara klik pada pilihan gambarnya.

Pilihlah gambar yang berbentuk balok

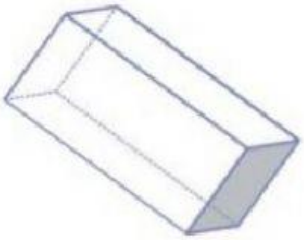

Pilihlah gambar yang berbentuk kubus

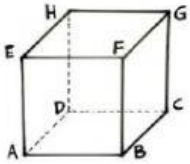



Pilihlah gambar yang berbentuk bola



Pilihlah gambar yang berbentuk tabung



LIVEWORKSHEETS

II. Tuliskan nama dari bangun datar/bangun ruang yang sesuai dengan gambar!

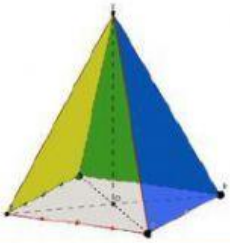





III. Pilihlah jawaban "Benar atau Salah" yang tersedia pada kotak

1. Alas dari kubus berbentuk persegi.
2. Alas dari tabung berbentuk segitiga.
3. Bola memiliki titik sudut

LIVEWORKSHEETS

IV. Isi dengan Gambar Benda yang Sama dengan Bangun Ruang Disamping!

Pindahkan Gambar Bangun Ruang Ke Dalam Kotak!

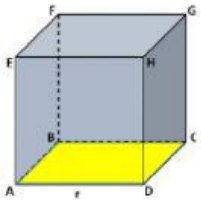

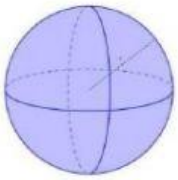

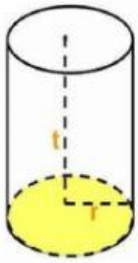



LIVEWORKSHEETS