MATHEMATICS
MATTHAYOM 4

Name: _____ No. ____ M.4/___

BASIC FUNCTIONS

Match the graph to the function definition.

A

_____ 1. $f(x) = c$

_____ 2. $f(x) = x$

_____ 3. $f(x) = x^2$

_____ 4. $f(x) = x^3$

_____ 5. $f(x) = |x|$

_____ 6. $f(x) = \sqrt{x}$

_____ 7. $f(x) = \frac{1}{x}$

B

a.

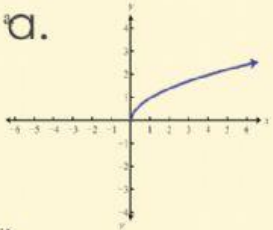

b.

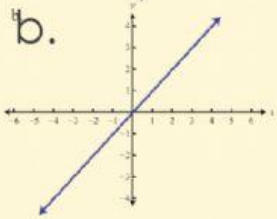

c.

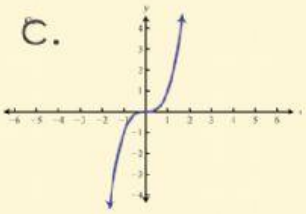

d.

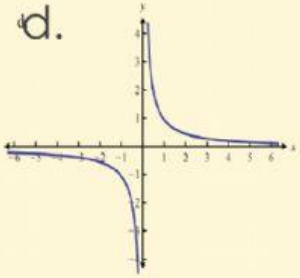

e.

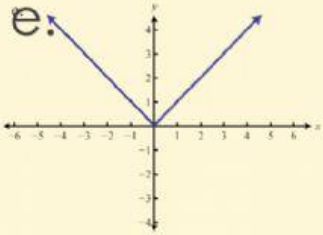

g.

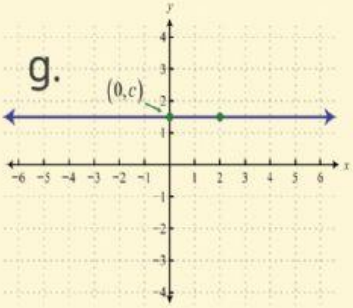

f.

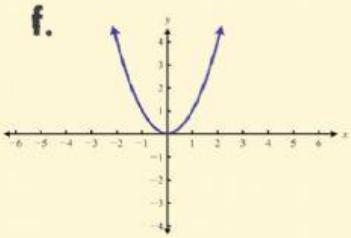

Teacher Master Allan

XXXXXXXXXXXXXX

LIVEWORKSHEETS