St. David's R.C School

STD 4 Mathematics

Christmas Test Term 1

Total 30 marks

ATTEMPT ALL QUESTIONS.

No.	QUESTION
1.	What is the time shown on the clock? (1 mark)  Answer_____
2.	The time is quarter past seven. Which clock shows the correct time. 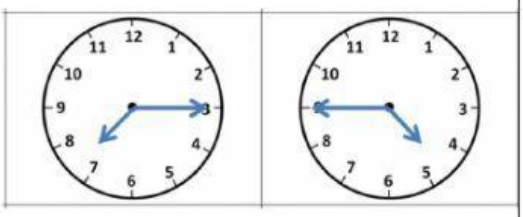 Clock A Clock B Answer _____ (1 mark)
3.	How many lines of symmetry does this letter have? (1 mark)  Answer _____

LIVEWORKSHEETS

4.	Is the dotted line on the shape below a line of symmetry? Write yes or no. (1 mark) 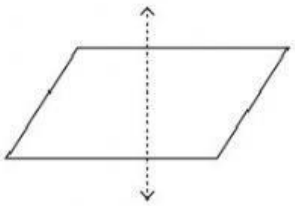 Answer _____
5.	 Look at the picture. Did the man make a a) Half turn b) Whole turn c) Quarter turn (1 mark)

LIVEWORKSHEETS

6.	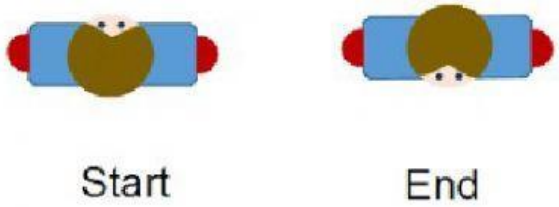 Look at the picture. Did the man make a a) Half turn b) Whole turn c) Quarter turn (1 mark)
7.	Name each angle below. 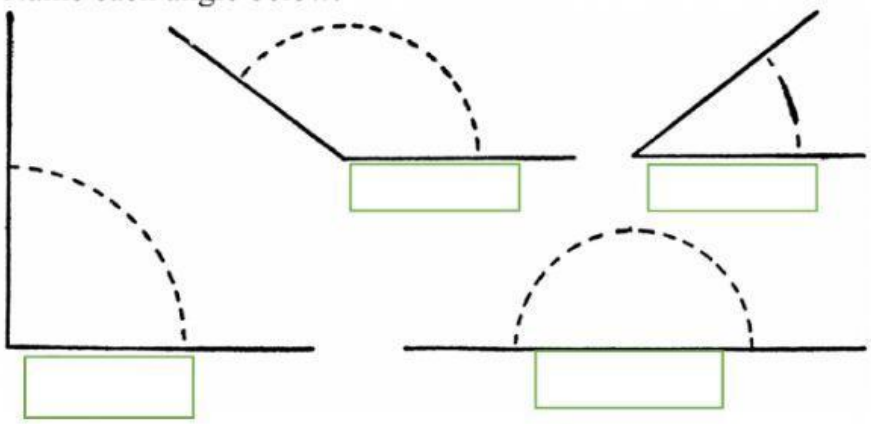 (4 marks)

LIVEWORKSHEETS

8.	Name the type of angles below. (3 marks) a) 155° Answer_____ b) 90° Answer _____ c) 35° Answer _____
9.	Name the angle shown on the clock. (1 marks) 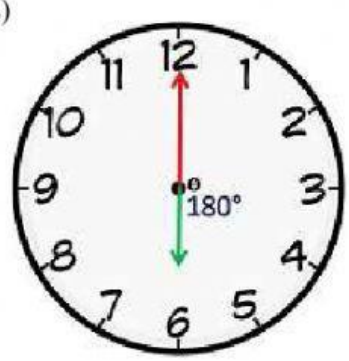 Answer_____
10.	Solve the problems below. (4 marks) a) $6\overline{)546}$ Answer _____ b) $3\overline{)342}$ Answer _____

LIVEWORKSHEETS

11.	Share 162 chocolates between 9 children. How many chocolates will each child get? (3 marks) Answer _____
12.	I need to put 118 pens into packets. Each packet can hold 6 pens. How many packets will I need to hold all the pens? (3 marks) Answer _____
13.	55 children get into teams of 4. a) How many teams of 4 can they make? (2 marks) Answer _____ b) How many children wil not be in a team of 4? (2 marks) Answer _____
14.	Niall has 238 oranges and needs to pack them up equally in 8 boxes. a) How many oranges go in each box? (2 marks) Answer _____ b) How much does he have left over? (1 mark) Answer _____

End of Test

LIVEWORKSHEETS