Republic of the Philippines
Department of Education
Region IV-A CALABARZON
City Schools Division of Bacoor
District of Bacoor I
SALINAS ELEMENTARY SCHOOL

Second Quarter Week 2 Math 1

Pangalan: _____

Gawain sa Pagkatuto Bilang 3: Unawaing mabuti ang bawat sitwasyon. Isulat ang tamang bilang sa bawat kahon.

1. **32 na pulang krayola**
   41 na puting krayola

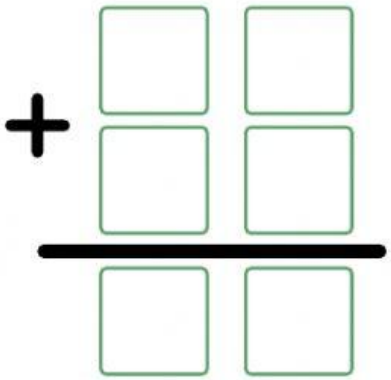

2. **28 na pulang rosas**
   50 na puting rosas

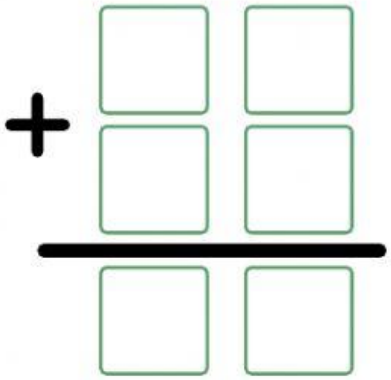

3. **32 na batang lalaki**
   27 na batang lalaki

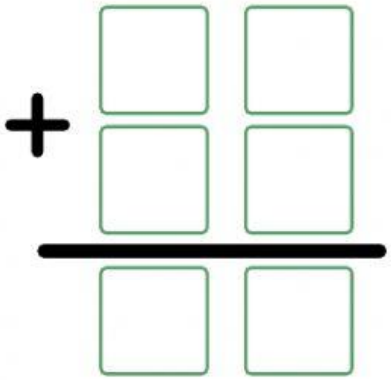

LIVEWORKSHEETS

4. 23 na puno ng atis
68 na puno ng mangga

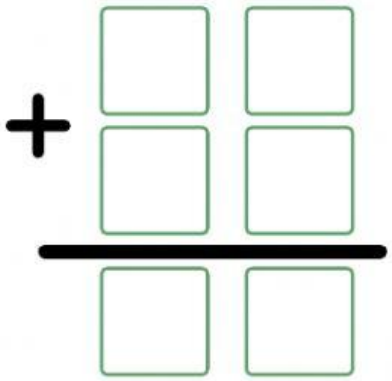

5. 53 na puno ng atis
27 na puno ng mangga

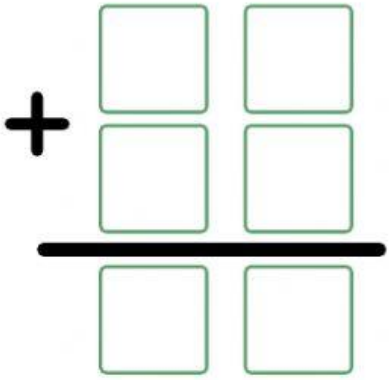

Gawain sa Pagkatuto Bilang 5: Suriin mo at unawain ang suliranin sa ibaba. Sagutan mo ang mga tanong.

Si Mica ay binigyan ng kanyang kuya ng 25 na puting holen, 37 na pulang holen at 19 na asul na holen. Ilan lahat ang holen ni Mica?

1. Sino ang nabanggit na bata sa suliranin? _____

2. Ilan ang puting holen ni Mica? _____

3. Ilan ang pulang holen? _____

4. Ilan ang asul na holen? _____

5. Ilan lahat ang holen ni Mica _____

LIVEWORKSHEETS