Àrea de matemàtiques	
Cicle mitjà	Concepte de multiplicació

M0065

v.31/08/2016

Quin és quin?

Quantes potes tenen en total?



3+3+3

- 3 x 3 = 9
- 2 x 3 = 6

Quantes flors hi ha?



2+2+2+2

- 3 x 2 = 6
- 4 x 2 = 8

Quantes espelmes hi ha?

2+2+2+2+2+2

- 6 x 2 = 12
- 2 x 5 = 10

Quantes potes tenen en total?



5+5

- 5 x 5 = 25
- 2 x 5 = 10

Quantes rodes hi ha en total?

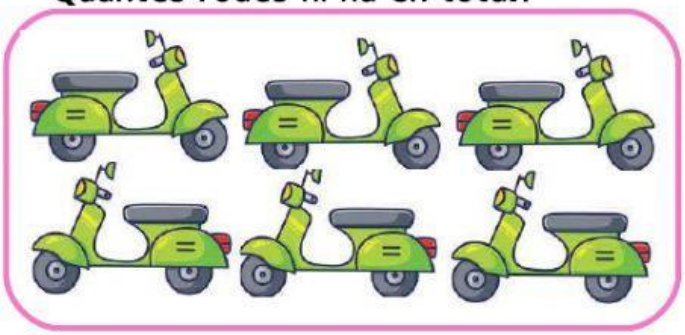

4+4

- 2 x 4 = 8
- 4 x 4 = 16

LIVEWORKSHEETS

Àrea de matemàtiques	
Cicle mitjà	Concepte de multiplicació

M0065 v.31/08/2016

Quantes boles hi ha?

10+10+10+10

2 x 10 =20

4 x 10 =40

Quants llapis hi ha en total?

6+6+6

3 x 6 = 18

3 x 6 = 18

Quantes boles de gelat hi ha?

8+8

2 x 8 = 16

8 x 8 = 64

Quants gatets hi ha?

3+3+3+3

3 x 3 = 9

4 x 3 = 12

LIVEWORKSHEETS