Grade I November Assessment
Concept

Less Than, Greater Than or Equal to

Compare the numbers by selecting the correct symbol.

10 > < = 20	9 > < = 4	11 > < = 11
16 > < = 6	7 > < = 7	8 > < = 18

Number Sets

Count the shapes. Select the number that shows how many in each set.

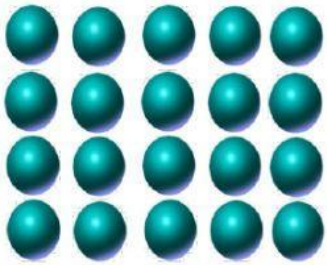

19 20 21

18 81 8



2 21 12

Solid Shapes

Draw a line to match the name to its shape.
Then match the shapes to the real world item it matches.

cylinder



rectangular prism

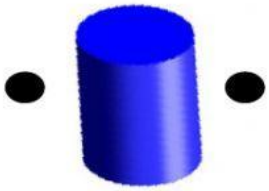



pyramid

LIVEWORKSHEETS

Least to Greatest

Arrange the numbers in order from least to greatest.

0 1 2 3 4 5 6 7 8 9 10 11 12 13 14 15 16 17 18 19 20

8 2 10 6

9 7 0 3

13 1 4 18

12 5 19 10

Symmetry

Select the shape that have a line of symmetry.

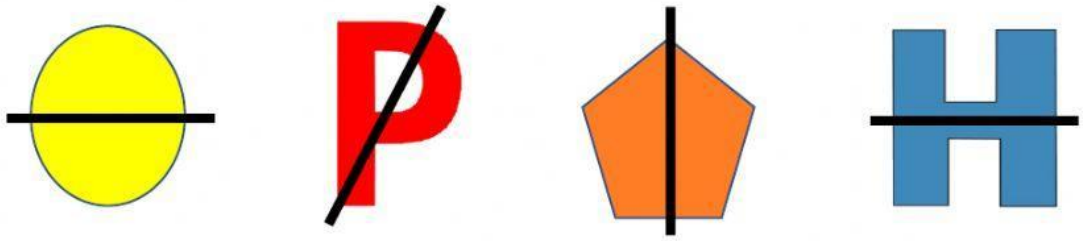

Patterns

Drag and drop the picture to complete the pattern.





LIVEWORKSHEETS