Ujian Sumatif Pendidikan Muzik Tahun 6

SK ST. Mary

Nama:_____ **Kelas:** _____

1. Pilih penjarian rekoder yang betul berdasarkan not di bawah.







2. Penjarian rekoder di bawah merupakan not _____.



not C not D not E

Susunkan (drag and drop) dinamik muzik di bawah dari lembut sehingga kuat.



lembut kuat

3. ? → mp → 4. ? → 5. ?



LIVEWORKSHEETS

Padankan symbol-simbol muzik dengan maknanya.

6.

- Not dibunyikan lebih panjang daripada nilai asalnya.

7. 

- Not pertama dilanjutkan sehingga not kedua. Kedua-dua not mempunyai pic yang berbeza.

8. 

- Not dimainkan sekali gus dan dipanjangkan sebanyak 2 detik krocet. Kedua-dua not mempunyai pic yang sama.

9. 

- Mewakili meter $\frac{4}{4}$

Padankan persembahan muzik yang betul berdasarkan muzik yang didengar.

nobat

gamelan

10. Muzik ini adalah persembahan _____?_____.

11. Muzik ini adalah persembahan _____?_____.

LIVEWORKSHEETS

Kira dan padankan meter.

12.

13.

●	$\frac{3}{4}$
●	$\frac{2}{4}$
●	$\frac{4}{4}$

Lengkapkan jadual di bawah. (Drag and drop)

Semibrif	Kuaver	Minim
1	3	

Jenis Not	Nama Not	Nilai Not	Tanda Rehat
	Krocet	14. ?	15. ?
	16. ?	2	17. ?
	18. ?	$\frac{1}{2}$	
	Minim Bertitik	19. ?	
	20. ?	4	

LIVEWORKSHEETS

Seret (drag and drop) ke dalam kotak kosong not yang bersesuaian dengan meter.



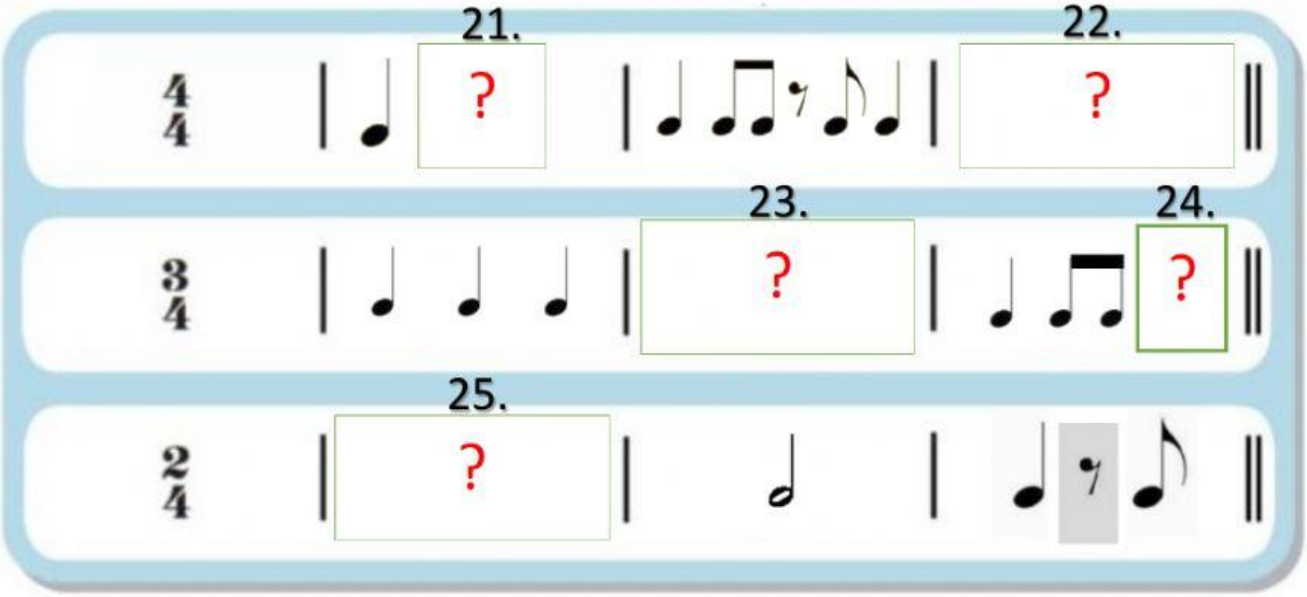

Tamat

LIVEWORKSHEETS