FRAÇÕES

Escreva a fração de acordo com o desenho:

$\frac{2}{3}$

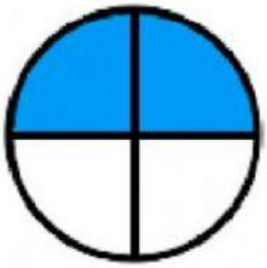

$\frac{\square}{\square}$

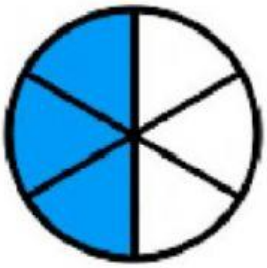

$\frac{\square}{\square}$

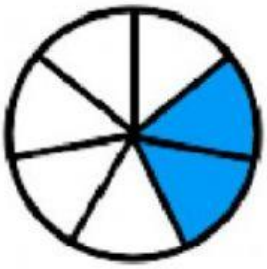

$\frac{\square}{\square}$

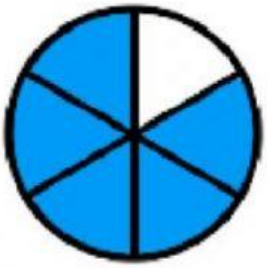

$\frac{\square}{\square}$

$\frac{\square}{\square}$

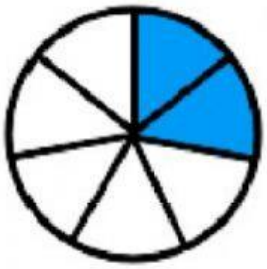

$\frac{\square}{\square}$

$\frac{\square}{\square}$

$\frac{\square}{\square}$

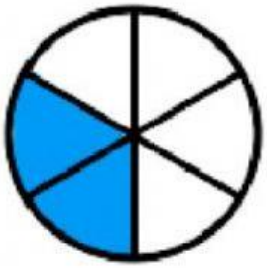

$\frac{\square}{\square}$

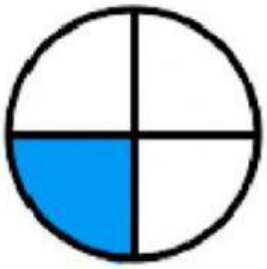

$\frac{\square}{\square}$

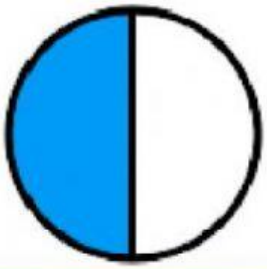

$\frac{\square}{\square}$

LIVEWORKSHEETS