Drag dan Drop the name of shape

3-D Shapes

Write the number represent face shape



___ flat face

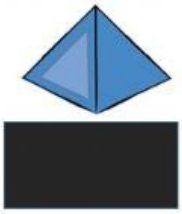

___ flat faces
___ vertices
___ straight edges

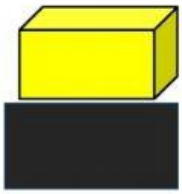

___ flat faces
___ vertices
___ straight edges

Cubes

Cuboid

Cones

Cylinder

Sphere

Pyramid



___ flat face
___ curved face
___ vertex

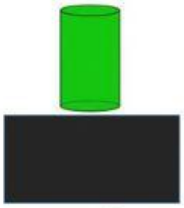

___ flat faces
___ curved face



___ flat faces
___ vertices
___ straight edges

LIVEWORKSHEETS