Name:

Practice 3 Telling the Amount of Money

1. How much money is there?

(a)

_____¢

(b)

_____¢

(c)

$_____

(d)

$_____

(e)

$_____

LIVEWORKSHEETS

2. Match the money to the correct things.

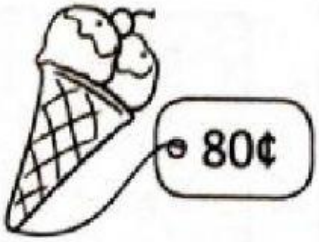

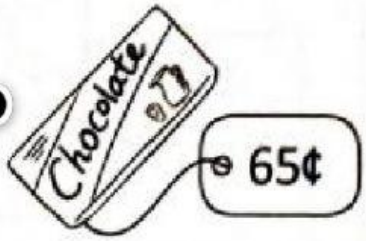

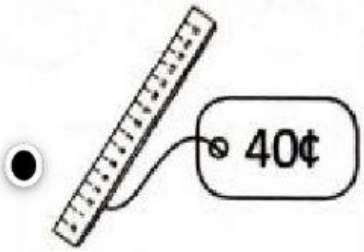

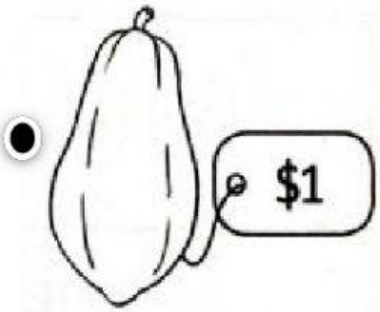



LIVEWORKSHEETS

3. Match the money to the correct things.



LIVEWORKSHEETS