Deacons Primary School

Infants B

End of Term 1 Test (December 2021)

Mathematics

Name:

_____

Class:

_____

Date:

_____

INSTRUCTIONS TO STUDENTS

1. This paper is made up of 17 questions.
2. Read **ALL** the instructions carefully.
3. **Check over** your work when you are finished.

LIVEWORKSHEETS

1. Match the numbers to the correct number names.

11	fifty-eight
39	seventy
58	eleven
70	Thirty-nine

2. Choose the correct symbol for each number sentence.

a) 40 88	b) 12 8	c) 70 70
<	<	<
>	>	>
=	=	=

LIVEWORKSHEETS

3. Fill in the missing numbers to complete the sequence.

d. 30, ____, ____, 33, 34, ____

e. ____, 63, 64, ____, ____

4. Put these numbers in order, starting with the smallest.

f.

21	10	33	42

g.

52	40	43	51

LIVEWORKSHEETS

5. (h) Select the shapes that show **HALF.**

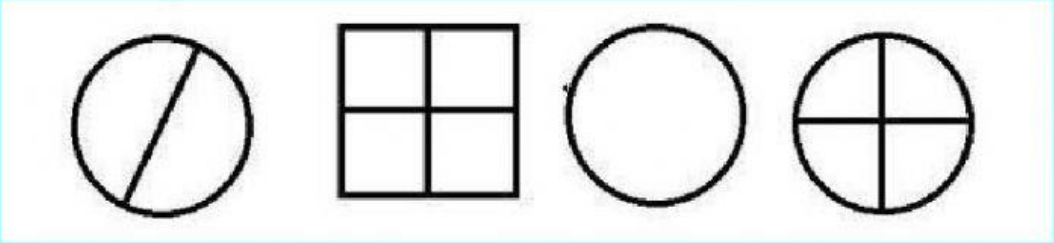

6. (i) Select the shapes that show **QUARTER**.

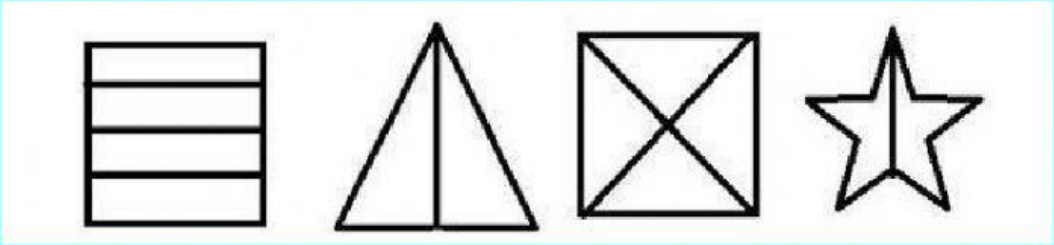

7. (j) Select the shapes that show 1 **WHOLE.**

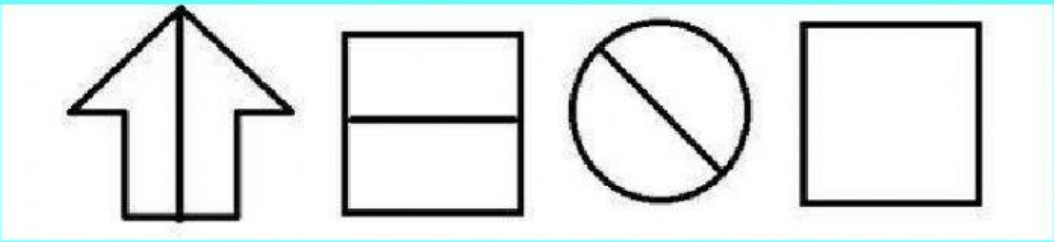

LIVEWORKSHEETS

8. Add

	Tens	Ones
	4	2
+	5	6

	Tens	Ones
	3	5
+	5	2

	Tens	Ones
	2	4
+	5	5

9. Add

	Tens	Ones
	2	3
+	4	8

	Tens	Ones
	3	7
+	4	7

	Tens	Ones
	5	8
+	2	3

LIVEWORKSHEETS

10. Subtract

$$\begin{array}{r} 16 \\ -\ 13 \\ \hline \end{array} \qquad \begin{array}{r} 19 \\ -\ 16 \\ \hline \end{array}$$

11. Subtract

19 - 12 = ☐

16 - 9 = ☐

12. Tens and Ones.

k. Select the numbers with 8 ones.

80	18	58	8	84

l. Select the numbers with 5 tens.

5	15	50	45	56

LIVEWORKSHEETS

13. What is the time? Drag and drop.

10:15	9:00	9:30

LIVEWORKSHEETS

14. How much money do I need?

Going to the Shop

10c	5c	5c
1c	10c	3c

+ =	+ + =
+ + =	+ =

LIVEWORKSHEETS

3D Shapes

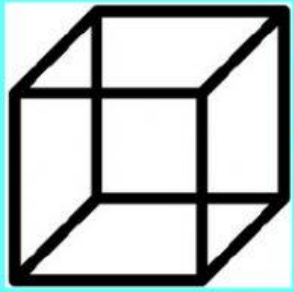

cube

15. A cube has _____ edges.

sphere

16. A sphere has _____ faces.

17. Select the cylinder shaped objects.



LIVEWORKSHEETS