POLYGON: PERIMETER - The Boundary of a Closed Plane Figure.

Name: _____ Number: _____ Grade: ____

NB: All answers in 'CM' except question: 2c in 'MM' & 3c; 4c; 7c which are in 'M'

Check your answers, take pictures and upload image via Class Point

Question 1: Workout the perimeter of each shape below

(a)

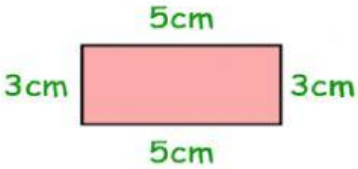

(b)

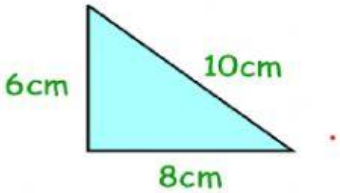

(c)

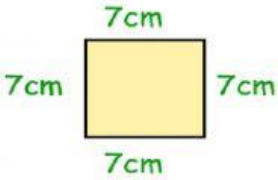

(d)

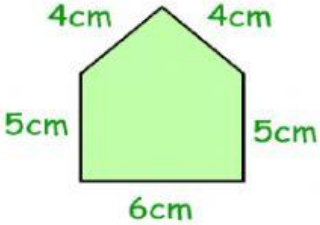

(e)

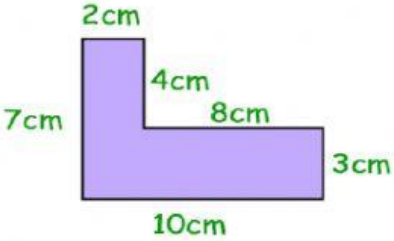

(f)

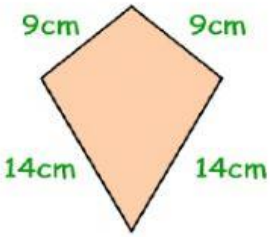

Question 2: Find the perimeter of each of these rectangles.

(a)

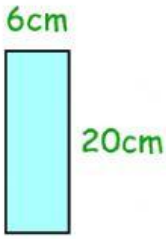

(b)

(c)

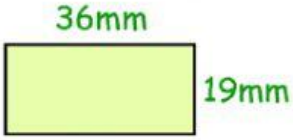

Question 3: Work out the perimeter of each of these squares

(a)



(b)



(c)



Answer Table for question 1 to 3: kindly drag your answers appropriately

24	136	3.6	46	16	28
24	110	60	52	34	48

LIVEWORKSHEETS

Find the answers for question 4 to 7 in the table below and carefully drag your answers.

24	213	13.5	0.78	24	42	14
42	85	58	26.5	54	24.8	

Question 4: Work out the perimeter of each of these equilateral triangles

(a)

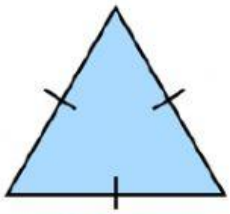

8cm

(b)

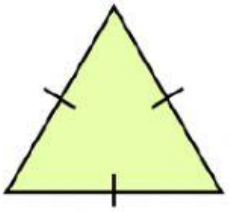

4.5cm

(c)

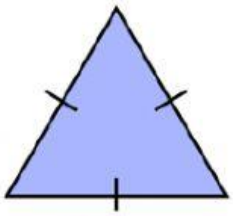

71m

(d)

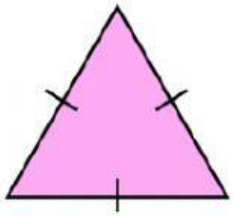

0.26cm

Question 5: Calculate the perimeter of each of these isosceles triangles

(a)

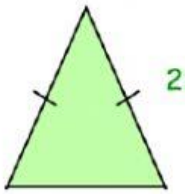

22cm

14cm

(b)

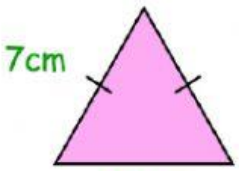

7cm

10cm

(c)

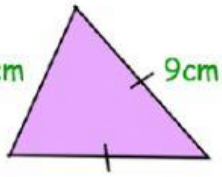

8.5cm

9cm

Question 6: Work out the perimeter of each of these regular shapes

(a)

7cm

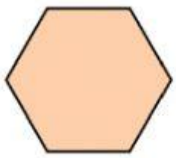

(b)

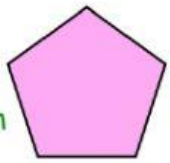

17cm

(c)

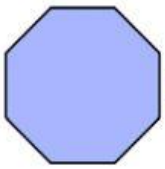

3.1cm

Question 7: Find the perimeter of each of these shapes

(a)

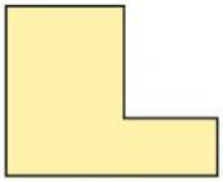

6cm

11cm

3cm

10cm

(b)

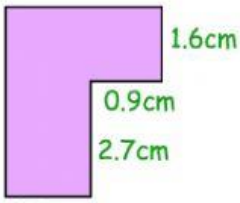

1.6cm

0.9cm

2.7cm

1.8cm

(c)

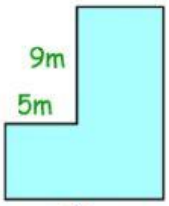

9m

5m

6m

12m

Upload your Image after you've checked your answers via Class Point or Line Id: gpower11. By T.OJO

LIVEWORKSHEETS