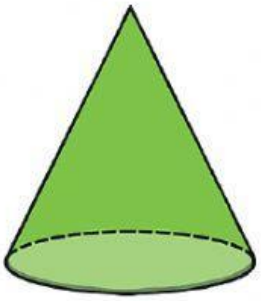

CONE

_____ faces _____ edges _____ corners



CYLINDER

_____ faces _____ edges _____ corners

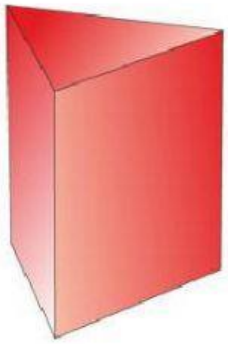

TRIANGULAR PRISM

_____ faces _____ edges _____ corners

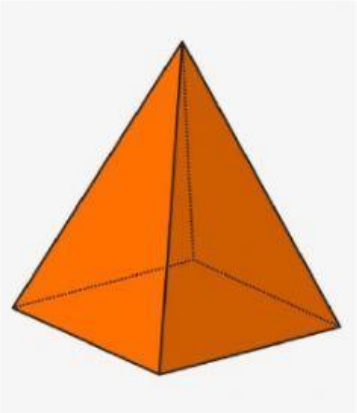

SQUARE PYRAMID

_____ faces _____ edges _____ corners

LIVEWORKSHEETS