Week 3 and 4 Math Assessment

Look at each number line. Write the multiplication fact.

1.

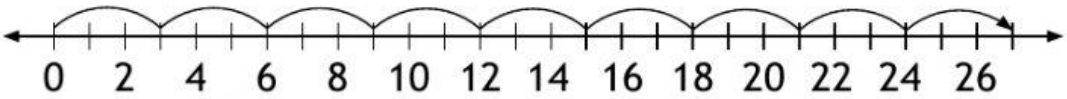

9 _____ x 3 _____ = 27 ____

2.

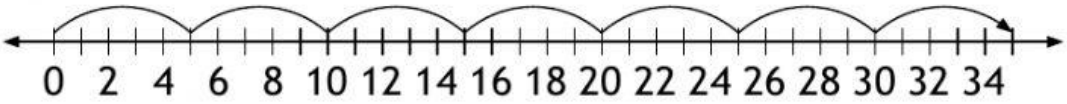

_____ × _____ = _____

3.

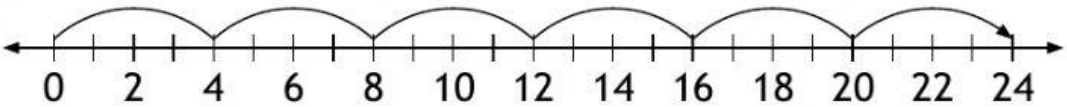

_____ × _____ = _____

4.

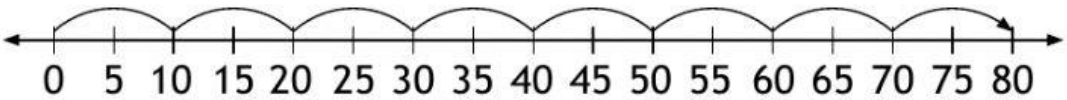

_____ × _____ = _____

© 2009 Marshall Cavendish International (Singapore) Private Limited. Copying is permitted; see page ii.

LIVEWORKSHEETS

Name:_____ Date: _____

Multiply. Use skip counting to help you.

5. $8 \times 2 =$ _____ **6.** $4 \times 4 =$ _____

7. $5 \times 0 =$ _____ **8.** $6 \times 3 =$ _____

9. $7 \times 4 =$ _____ **10.** $8 \times 5 =$ _____

11. $6 \times 10 =$ _____ **12.** $7 \times 3 =$ _____

Fill in the missing numbers.

13. $4 \times$ 5 $=$ 5 $\times 4 = 20$

14. _____ $\times 3 = 3 \times$ _____ $= 24$

15. $10 \times$ _____ $=$ _____ $\times 10 = 90$

16. _____ $\times 5 = 5 \times$ _____ $= 45$

© 2009 Marshall Cavendish International (Singapore) Private Limited. Copying is permitted; see page ii.

LIVEWORKSHEETS

Fill in the missing numbers.

17. 6 sixes = 6 x ____

18. 5 x 6= _____ sixes

19. 8 + 8 +8 + 8 + 8 +8 = 6 X _____

20. 6 + 6 + 6 + 6 + 6+ 6 + 6 + 6= 8 x _____

21. 10 X 5 = 5 x _____

22. 4 sevens = 7 + 7 +7 + ____

Multiply. Use multiplication facts you know to find other multiplication facts.

23. 6 x 5 = 6____ groups of 5

5 groups of 5 + 1____ group of 5

25_____+ _____

= _____

24. 5 x 6 = 30___

6 x 6 = 6___ groups of 6

= 5 groups of 6 +_____groups of 6

_____+ _____

= _____

25. 9 x 6 = 54

8 x 6 = _____ groups of 6

= 9 groups of 6 - _____ groups of 6

= _____ - _____

= _____

© 2009 Marshall Cavendish International (Singapore) Private Limited

LIVEWORKSHEETS