Colegio Nourish

2021-2022 **2nd. Grade**

November Exam **Math**

Name: _____ **List #** _____

Date: _____ **Teacher: Jacklenis Salazar**

I. Use partial sums to solve the problems. (1-3).

Find 68 + 29.

	Tens	Ones
	6	8
+	2	9
Tens: ___ + ___ =		
Ones: ___ + ___ =		
___ + ___ =		

Find 19 + 46.

	Tens	Ones
	1	9
+	4	6
Tens: ___ + ___ =		
Ones: ___ + ___ =		
___ + ___ =		

Find 58 + 24.

	Tens	Ones
	5	8
+	2	4
Tens:		
Ones:		
Sum:		

LIVEWORKSHEETS

2. Solve the following additions. Regroup if you need.

4.

	Tens	Ones
	☐	
	3	6
+	2	9

5.

	Tens	Ones
	☐	
	2	7
+	2	3

6.

	Tens	Ones
	☐	
	5	9
+	1	3

3. Add more than digit numbers. Regroup if you need.

7.
$$\begin{array}{r} 27 \\ 13 \\ +\ 21 \\ \hline \end{array}$$

8.
$$\begin{array}{r} 13 \\ 33 \\ +\ 25 \\ \hline \end{array}$$

9.
$$\begin{array}{r} 25 \\ 21 \\ +\ 32 \\ \hline \end{array}$$

4. David counts 16 stars. Then, he counts 18 stars. How many stars does David count in all? (10).

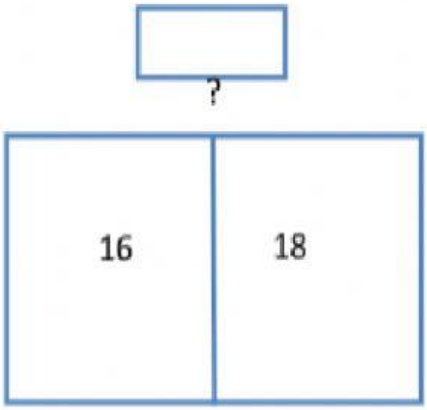

16 + 18 = 34

18 - 16 = 2

LIVEWORKSHEETS

5. Oscar has 34 crayons. Mike has 14 more than Oscar. How many crayons does Mike have? (11).

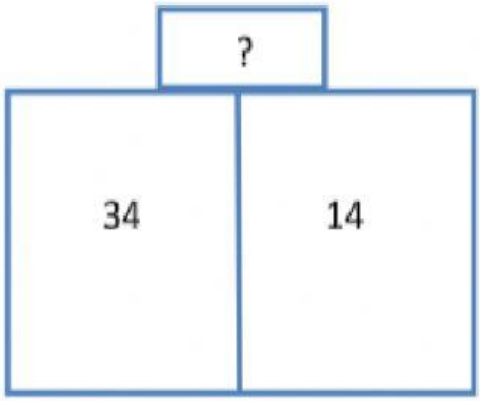

34 + 14 = 48

34 - 14 = 11

6. Say Yes if you need to regroup or say No if you don't need to regroup (12-14).

- 34 + 67 **Yes** **No**
- 94 + 83 **Yes** **No**
- 87 + 44 **Yes** **No**

7. Answer the next subtractions using HUNDRED CHART (15-16).

1	2	3	4	5	6	7	8	9	10
11	12	13	14	15	16	17	18	19	20
21	22	23	24	25	26	27	28	29	30
31	32	33	34	35	36	37	38	39	40
41	42	43	44	45	46	47	48	49	50
51	52	53	54	55	56	57	58	59	60
61	62	63	64	65	66	67	68	69	70
71	72	73	74	75	76	77	78	79	80
81	82	83	84	85	86	87	88	89	90
91	92	93	94	95	96	97	98	99	100

LIVEWORKSHEETS

57-12= 77-20=

8.Choose the correct answer using OPEN NUMBER LINE (17-18).

60 – 30 =

34 – 10 =

9. Choose YES or NO if the difference is correct using break apart (19-20).

47 – 8 = 39

YES NO

75 – 38 = 37

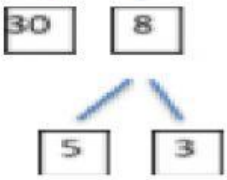

YES NO

LIVEWORKSHEETS