Level: Grade 6

Name: _____ **Student's No.:** _____ **Level/Class:** **P6/1**

TOPIC: Triangles

I. Classify each triangle based on the characteristics of the sides.

1) 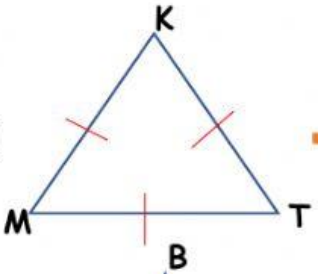

The triangle MKT is a/an _____

2) 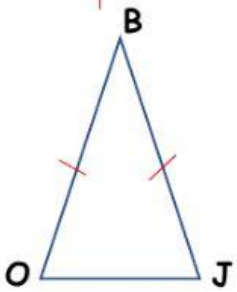

The triangle OBJ is a/an _____

3) 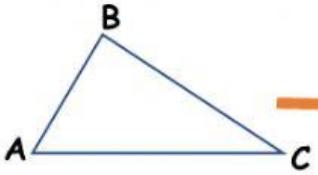

The triangle ABC is a/an _____

II. Classify each triangle based on the characteristics of the angles.

4) 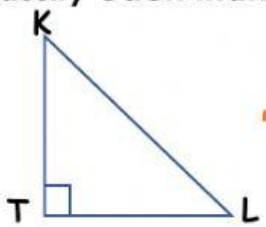

The triangle TKL is a/an _____

5) 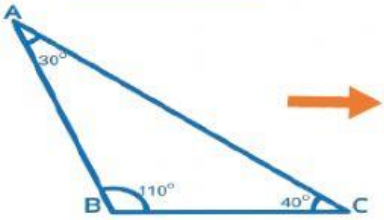

The triangle ABC is a/an _____

6) 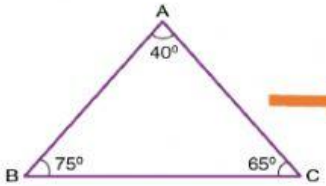

The triangle BAC is a/an _____

LIVEWORKSHEETS

III. Find the perimeter of the triangles.

7)

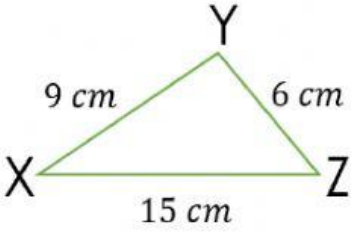

The perimeter of the triangle XYZ is _____.

8)

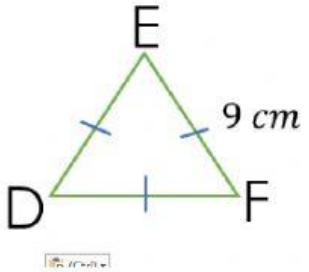

The perimeter of the triangle DEF is _____.

9)

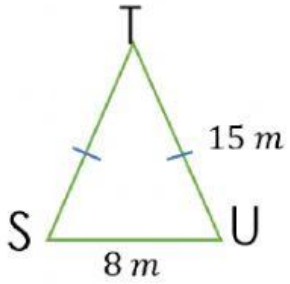

The perimeter of the triangle STU is _____.

---

10)

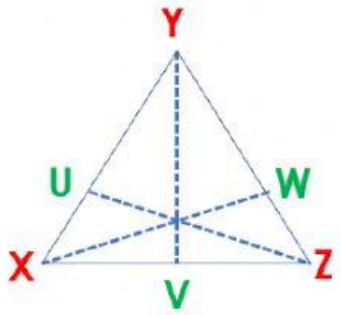

_____

For the base $\overline{XZ}$ *, the height is* _____.

_____

For the base $\overline{YZ}$ *, the height is* _____.

_____

For the height $\overline{UZ}$ *, the base is* _____.

LIVEWORKSHEETS