Name: _____ Set:_____

Isomerism

1. The compounds below show the possible isomers of C_6H_{12} which contain a double bond.

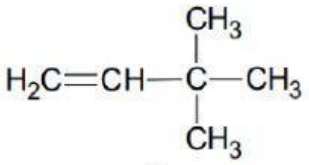

A

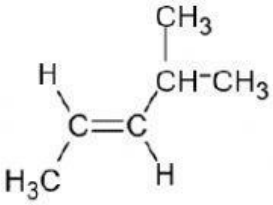

B

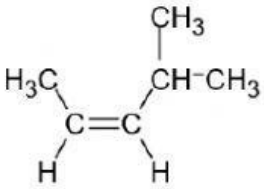

C

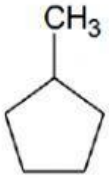

D

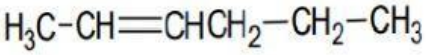

E

(a) Select which isomer is chain isomer. _____

(b) Select which isomer is positional isomer. _____

(c) Select which isomer is functional isomer. _____

(d) Identify which 2 isomers show stereoisomerism, name the isomers and state the type of stereoisomerism shown.

Isomers: _____

Name of isomers: _____

Type of stereoisomerism: _____

2. The compounds below show the possible isomers of $C_5H_{11}Br$.

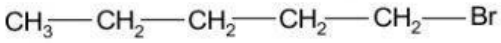

A

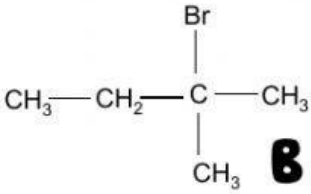

B

C

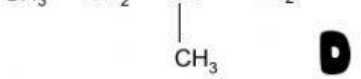

D

(a) Identify two molecules which are chiral. _____

(b) Explain briefly how they could be distinguished.

_____

LIVEWORKSHEETS