Phiếu bài tập Toán

Tên:

Lớp:

Số 9

Câu 1: Nối hình với số tương ứng



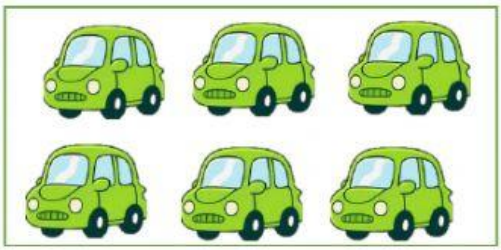



5

7

6

3

8

9



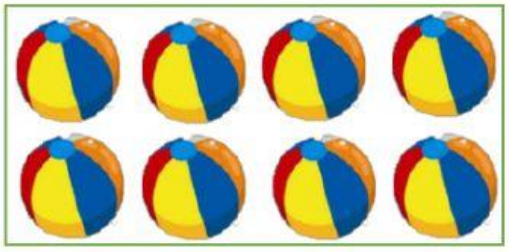



Câu 2: Sắp xếp các số theo thứ tự

a) Từ lớn đến bé

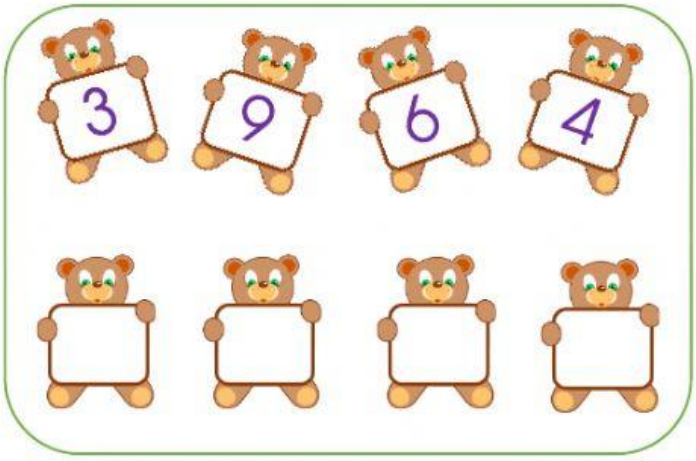

b) Từ bé đến lớn

LIVEWORKSHEETS

Câu 3: Số?

6 < ☐ < 8 9 > ☐ > 6 2 < ☐ < 9

7 > ☐ > 3 9 = ☐ 9 > ☐

Câu 4:

>	4	9	5	6
<	3	2	7	7
=	9	6	1	8

Câu 5: Số?

9	8		6		9
	1	7		5	

8	4		5		0
	4	7		2	

Câu 6: Số?

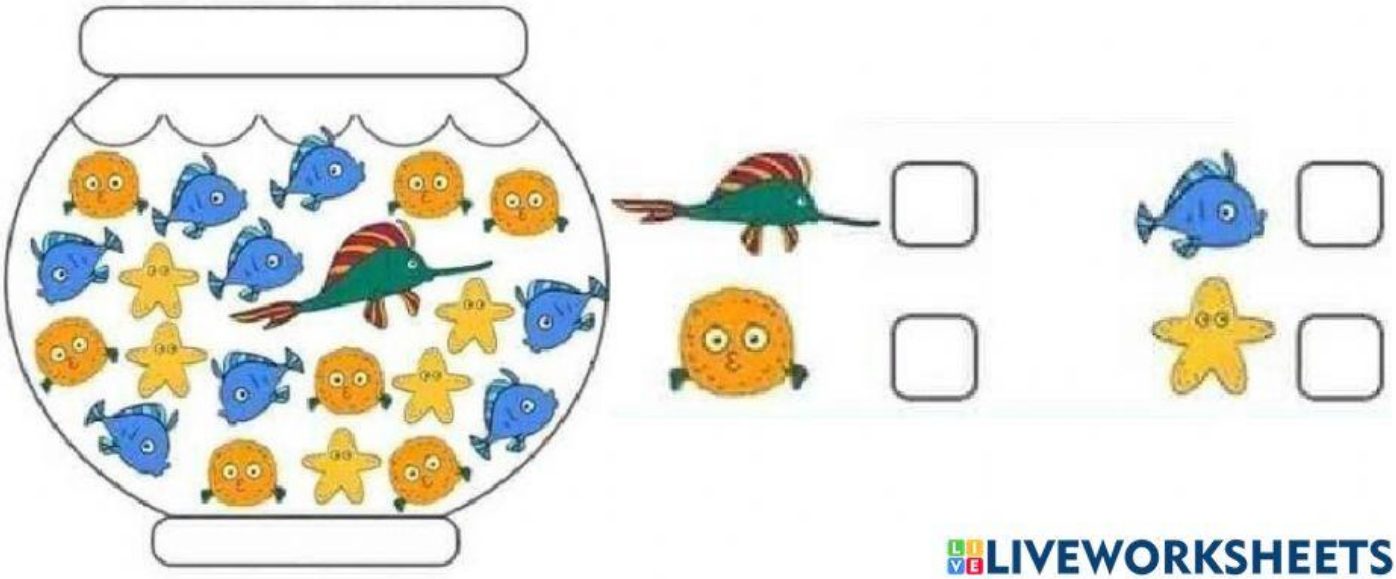

LIVEWORKSHEETS