TÊN:

LỚP:

PHIẾU BÀI TẬP TOÁN

SỐ 9

Câu 1: Nối hình với số tương ứng:





5

7

6

3

8

9



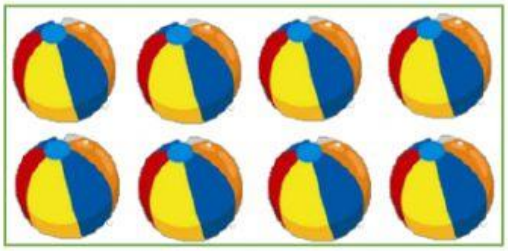

Câu 2: Số?

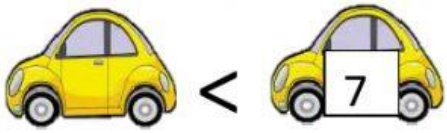



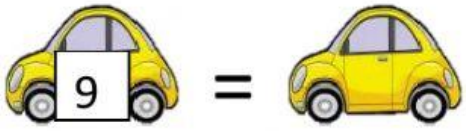

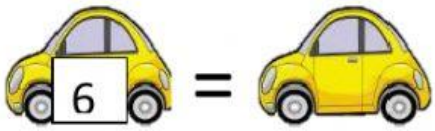



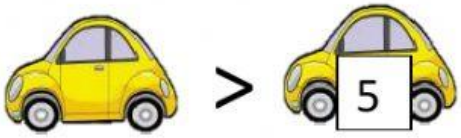

LIVEWORKSHEETS

Câu 3: Đếm hình.

Có ..... 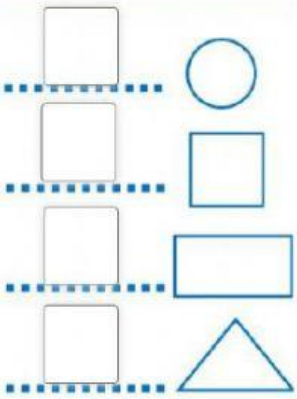



Câu 4: Số ?



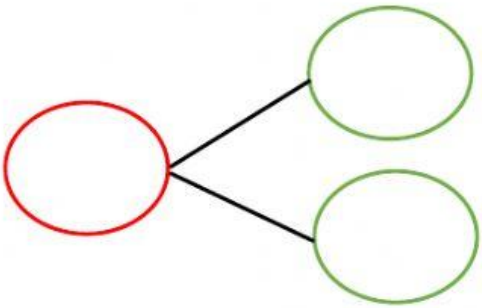

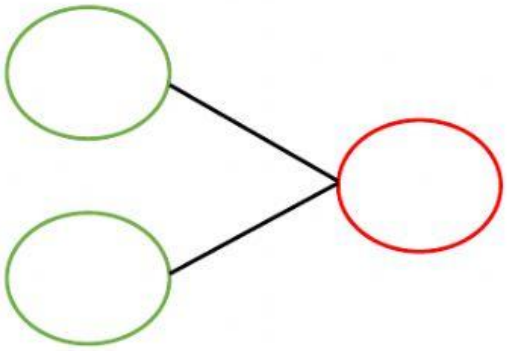

LIVEWORKSHEETS