Year 5 Mathematics

NAME: _____ DATE : TUESDAY 9th NOVEMBER, 2021

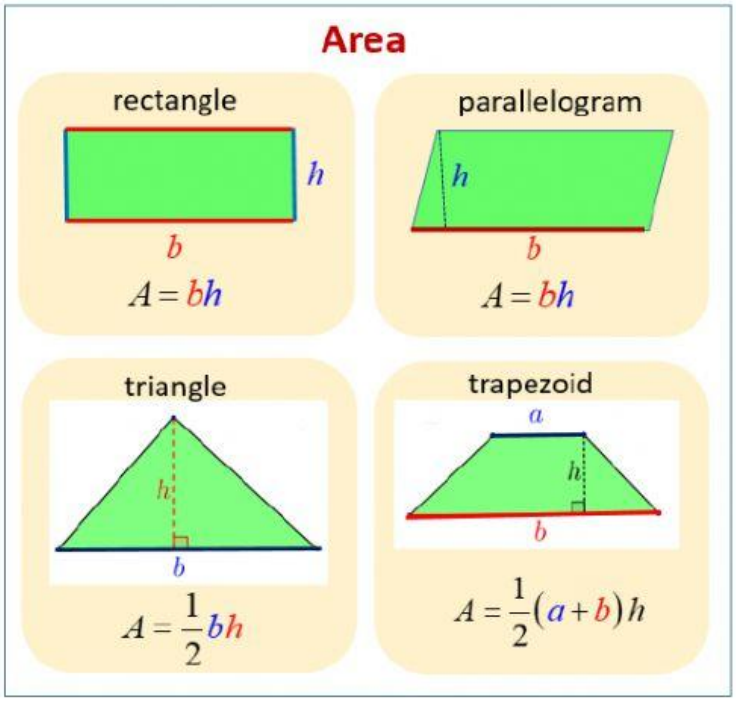

A. Find the area of the triangles and parallelogram below.

1

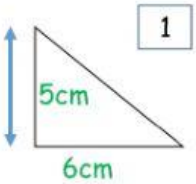

Area = $\frac{b \times h}{2}$

Area = $\frac{6cm \times 5cm}{2}$

Area =_____cm^2

2

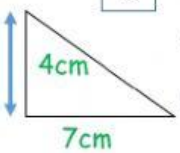

Area = $\frac{b \times h}{2}$

Area =

Area =_____cm^2

3

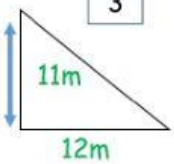

Area = $\frac{b \times h}{2}$

Area =

Area =_____m^2

4

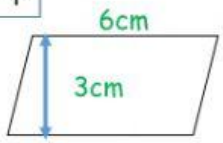

Area = b x h

Area = 6cm x 3cm

Area =_____cm^2

5

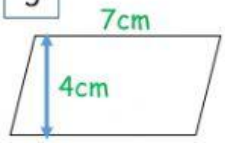

Area = b x h

Area =

Area =_____cm^2

6

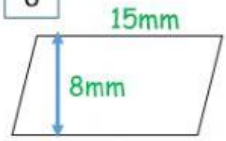

Area = b x h

Area =

Area =_____mm^2

LIVEWORKSHEETS

Area of Triangles and Parallelograms Worksheet

Find the area of the following triangles

1

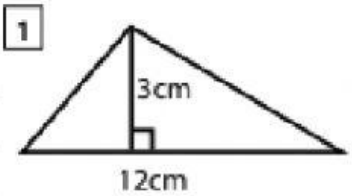

2

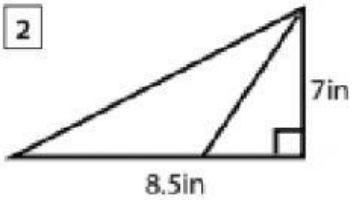

3

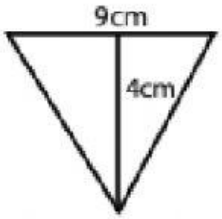

4

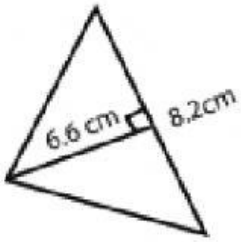

5

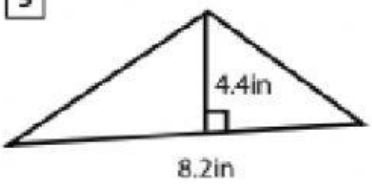

6

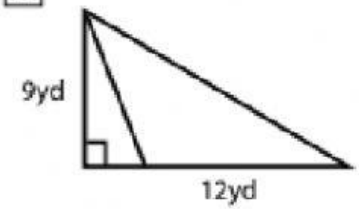

Find the area of the following parallelograms.

7

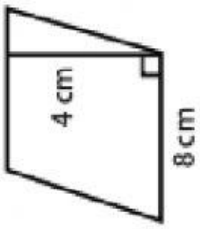

8

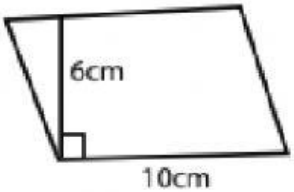

9

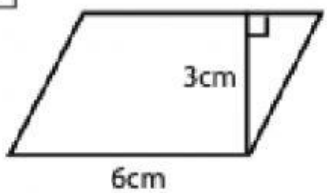

10

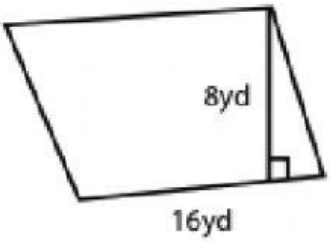

11

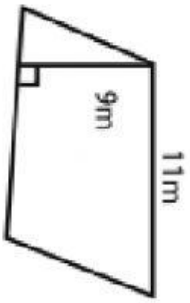

12

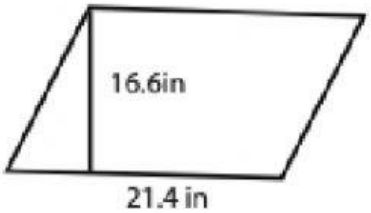

LIVEWORKSHEETS