2. Find the perimeter of each figure.
Give your answers in the correct units.

(a)

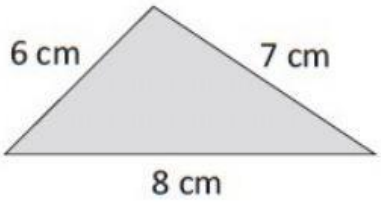

Perimeter = _____ + _____ + _____

= _____

(b)

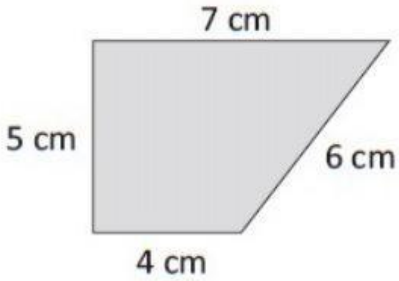

Perimeter = _____ + _____

+ _____ + _____

= _____

(c)

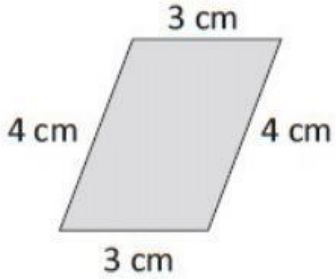

Perimeter = _____ + _____

+ _____ + _____

= _____

(d)

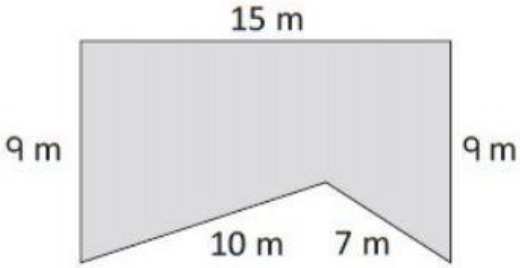

Perimeter = _____

(e)

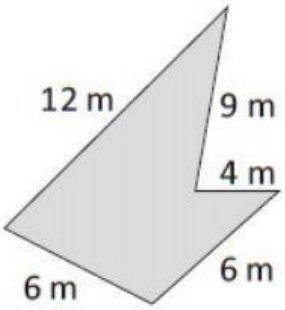

Perimeter = _____

LIVEWORKSHEETS