Kalkulatu ondoko poligonoen perimetroa eta idatzi emaitza. Zenbakia eta cm jarri behar dituzu orrialdea ondo zuzentzeko **espazioak utzi gabe**.

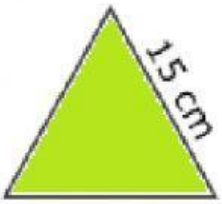

P = ☐

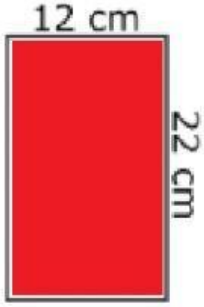

P= ☐

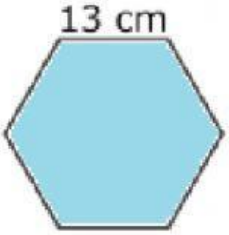

P = ☐

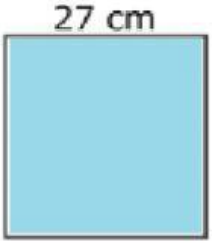

P = ☐

P= ☐

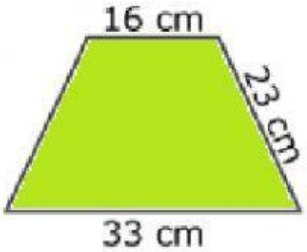

P = ☐

P = ☐

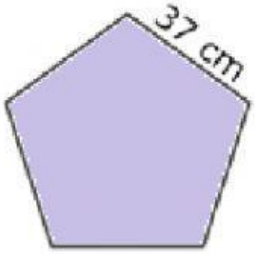

P= ☐

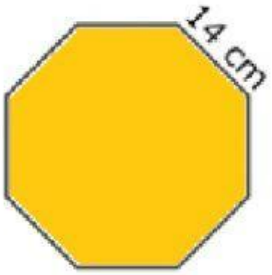

P = ☐

LIVEWORKSHEETS