Name: _____ Date: _____

Multiplication Sentences

1 Write the missing numbers.

(a)

3 groups of ☐

2 + 2 + 2 = ☐

3 × 2 = ☐



(b)

2 groups of ☐

6 + 6 = ☐

2 × 6 = ☐

(c)

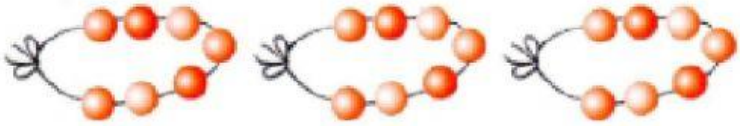

3 groups of ☐

☐ + ☐ + ☐ = ☐

3 × ☐ = ☐

LIVEWORKSHEETS

2 Complete the multiplication stories.

(a)

There are _____ holders.

Each holder has _____ toothbrushes.

☐ × ☐ = ☐ + ☐ + ☐ + ☐ + ☐

= ☐

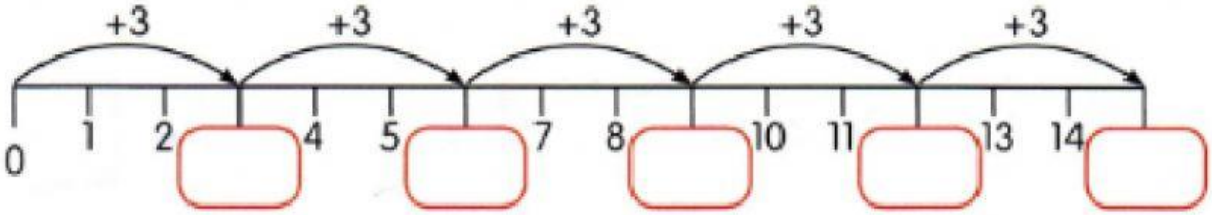

There are _____ toothbrushes altogether.

(b)

There are _____ plates.

Each plate has _____ cookies.

☐ × ☐ = ☐ + ☐ + ☐ + ☐

= ☐

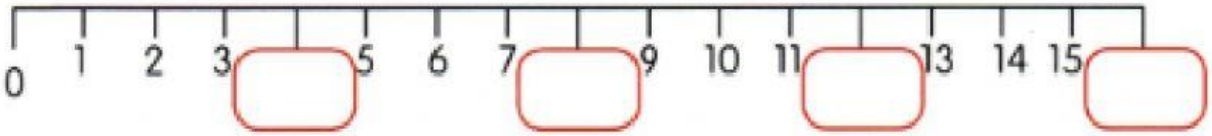

There are _____ cookies altogether.

LIVEWORKSHEETS

3 Match.

(a) $2 + 2 + 2 + 2 + 2$ • • 3×7

(b) $7 + 7 + 7$ • • 6×3

(c) $4 + 4$ • • 4×5

(d) $5 + 5 + 5 + 5$ • • 6×6

(e) $3 + 3 + 3 + 3 + 3 + 3$ • • 5×2

(f) $6 + 6 + 6 + 6 + 6 + 6$ • • 2×4

Self reflection

How did you do the worksheet? (write A/B/C)

A. I did it by myself

B. I did it with a little help

C. I did it with a lot of help

LIVEWORKSHEETS