Name: _____Student Number: ___

Measuring Length in Meters and Centimeters

Sentence Structure

Q: What is the length of the pencil?

A: It's ___ cm.



Sentence Structure

Q: What is the length of the rope?

A: It's ___ m or _____ cm.



Sentence Structure

Q: What is the length of the decorative lights?

A: It's ___ m _____ cm.

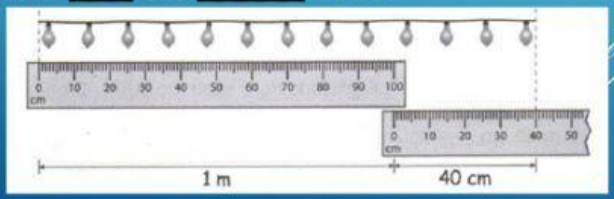

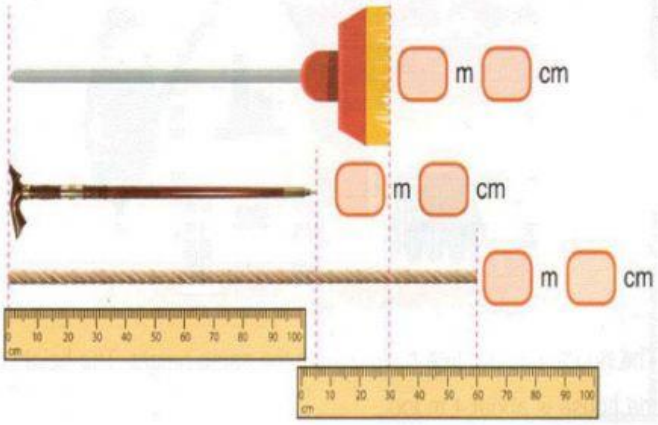

LIVEWORKSHEETS