Department of Education
Region III
Schools Division Office- City of Malolos
District 1
BARASOAIN MEMORIAL INTEGRATED SCHOOL
School I.D 501231
Tel. No. (044)791-6318

LEARNING ACTIVITY SHEET
MATHEMATICS
MODULE 8 (Aralin 2)

Pangalan: _____ 1-_____

Ordering numbers in increasing or decreasing order

Panuto: Ayusin ang tamang pagkakasunod-sunod ng mga larawan o bilang mula sa pinakakaunti hanggang sa pinakamarami batay sa bilang nito.

1. 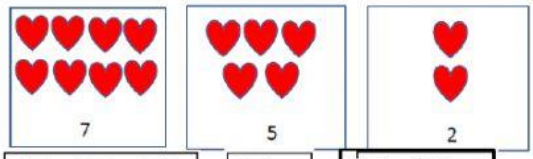

_____ _____ _____

2. 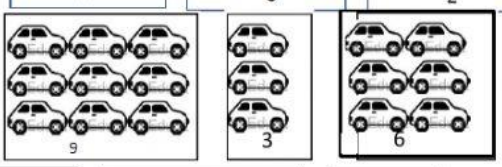

_____ _____ _____

3. 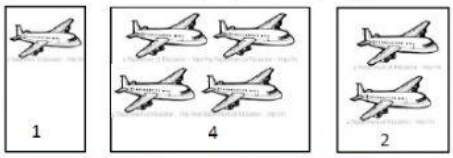

_____ _____ _____

4. **10** **30** **20**
_____ _____ _____

5. **27** **23** **20**
_____ _____ _____

Panuto: Ayusin ang mga bilang mula sa pinakakunti hanggang sa pinakamarami (increasing order) at mula sa pinakamarami hanggang sa pinakakaunti (decreasing order).

	Increasing order	Decreasing order
1) 13, 11, 12, 10		
2) 25, 27, 28, 30		
3) 33, 22, 12, 8		
4) 80, 70, 60, 50		
5) 55, 65, 75, 90		

Pangalan at Lagda ng Magulang: _____

LIVEWORKSHEETS