SEKOLAH KEBANGSAAN PEKAN RABU
ABA 5067
MATHEMATICS YEAR 4

NAME : _____ DATE : 1/11/2021

VOLUME

Calculate the volume of cube L, cuboid M, and a tissue box.

a

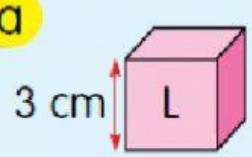

Volume of cube L
= length x width x height
= _____ cm x _____ cm x _____ cm
= _____ cm^3

b

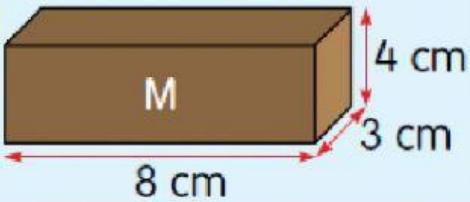

Volume of cuboid M
= length x width x height
= ____ cm x ____ cm x ____ cm
= _____ cm^3

c

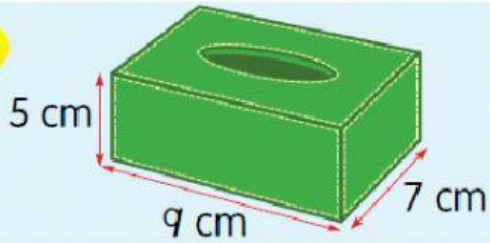

Volume of tissue box
= length x width x height
= ____ cm x ____ cm x ____ cm
= _____ cm^3

T'cher Aja

LIVEWORKSHEETS LIVEWORKSHEETS