Number Sets

Count each set of objects. Draw a line from each numeral to match the correct number set.

3

5

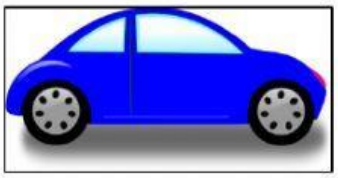

1

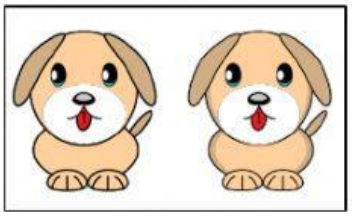

2

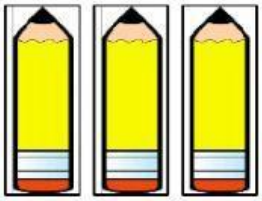

4

LIVEWORKSHEETS