TAGORE INTERNATIONAL SCHOOL
VASANT VIHAR, NEW DELHI
MATH WORKSHEET
CLASS IV

Name_____ **Class & Sec** _____ **Date**_____

Q1. Look at the pattern and complete the series.

a) 2, 12, 22, 32, 42, _____, _____, _____.

b) 26, 24, 22, 20, 18, _____, _____, _____.

c) A1, B2, C3, D4, _____, _____, _____, _____.

d) ABA, CDC, EFE, GHG, _____, _____, _____.

e) 1, 2, 4, 8, _____, _____, _____.

f) 5, 6, 9, 14, 21, _____, _____, _____.

g) Ab2625, Cd2423, Ef2221, Gh2019, _____, _____, _____.

Q2. Look at the pattern and complete the number towers.

a)

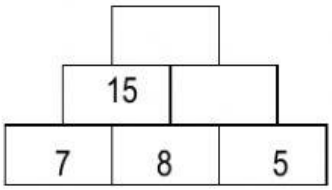

b)

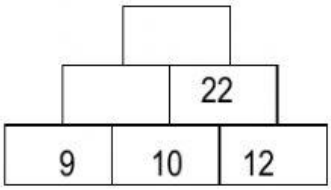

c)

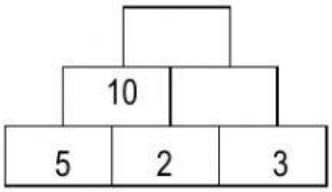

d)

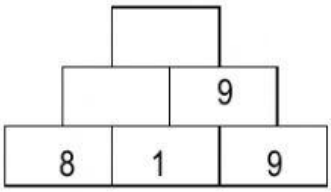

e)

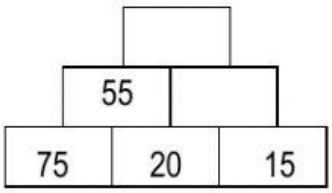

f)

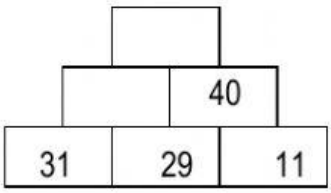

LIVEWORKSHEETS

Identifying Number Pattern

Identify the number pattern and fill in the missing numbers.

1)	2	4	6	8	10					
2)	17	19	21	23	25					
3)	48	44	40	36	32					
4)	10	15	20	25	30					
5)	27	25	23	21	19					
6)	6	12	18	24	30					
7)	1	3	5	7	9					
8)	40	38	36	34	32					
9)	12	15	18	21	24					
10)	32	30	28	26	24					

LIVEWORKSHEETS