Name: _____

Date: _____

Math Concepts Revision #2: Place Value, Ascending and Descending

hundreds	tens	ones
4	3	1

A. **Directions:** Type in the boxes below by using the words **Hundreds, Tens,** or **Ones** to show the place of the underline digit.

2<u>4</u>9	<u>9</u>57	2<u>5</u>2	<u>5</u>62
_____	_____	_____	_____

B. **Directions:** Type in the boxes below to order the numbers in **ascending order.**



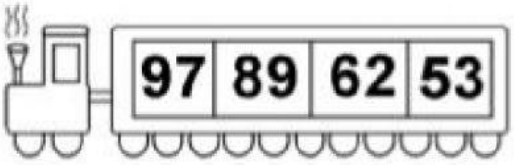

C. **Directions:** Type in the boxes to order the numbers in **descending order**.

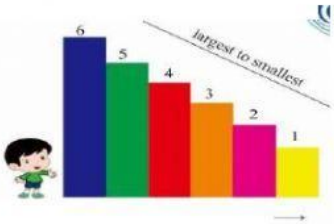

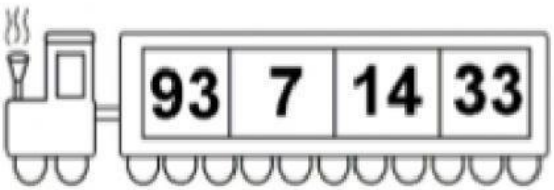

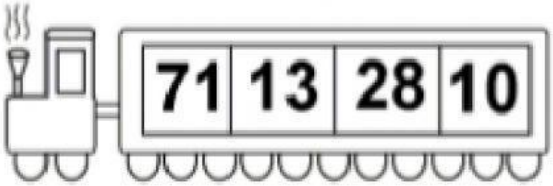

LIVEWORKSHEETS

Equal to

Greater than

Lesser than

D. Directions: Complete the pattern below.

12 ◯ 36

41 ◯ 79

14 ◯ 14

E. Directions: Write the numbers for the base ten blocks below.

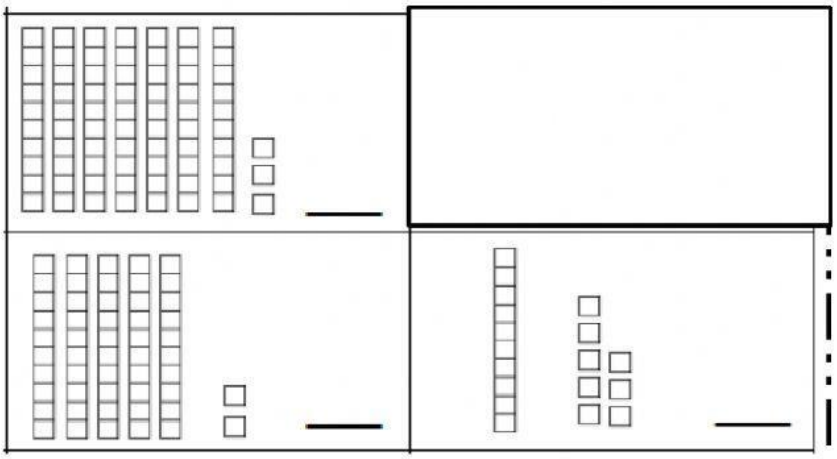



LIVEWORKSHEETS