NAME : SECTION : ROLL No.

**1** Write the number which is add one more to the given objects. One has been done for you.

| | | One more | Numbers |
|---|---|---|---|
| (a) |  | + = | 5 |
| (b) | | + = | _____ |
| (c) | | + = | _____ |
| (d) | | + = | _____ |
| (e) | | + = | _____ |
| (f) | | + = | _____ |
| (g) | | + = | _____ |
| (h) | | + = | _____ |
| (i) |  | + = | _____ |
| (j) | | + = | _____ |

LIVEWORKSHEETS

NAME : SECTION : ROLL No.

**1** How many altogether ? One has been done for you.

(a)



4 hens and



3 hens is equal to



7 hens

(b)

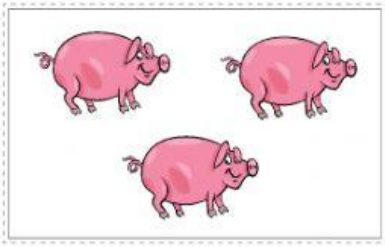

☐ pigs and



☐ pig is equal to

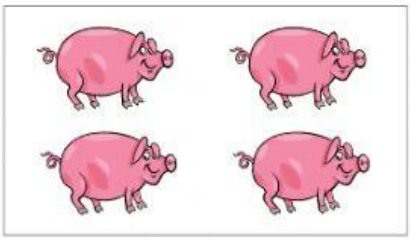

☐ pigs

(c)

☐ car and

☐ cars is equal to

☐ cars

(d)

☐ icecreams and



☐ icecreams is equal to



☐ icecreams

(e)



☐ bananas and



☐ bananas is equal to



☐ bananas

LIVEWORKSHEETS

NAME : SECTION : ROLL No.

**1** Add and write the missing numbers.

(a)



☐ and ☐ = ☐

(b)

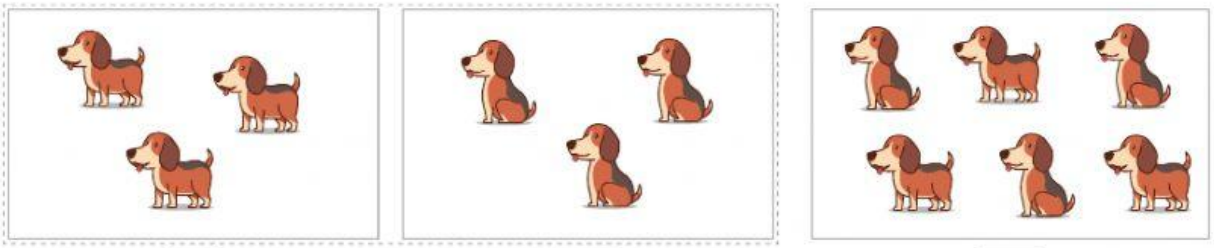

☐ and ☐ = ☐

(c)

☐ and ☐ = ☐

(d)

☐ and ☐ = ☐

(e)

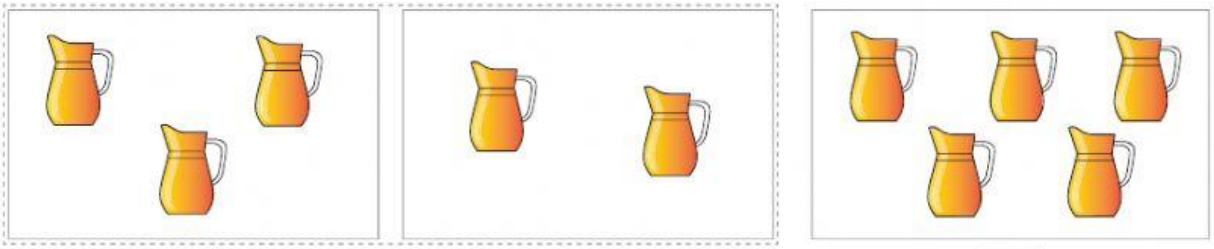

☐ and ☐ = ☐

LIVEWORKSHEETS