الإمارات العربية المتحدة
وزارة التربية والتعليم

worksheet 2-1 Exponential Function

المدرسة الإماراتية

Mleih School **Grade :10 General**

Name : ..... **Date : 26/10/2021**

Classify each exponential function to Growth or Decay:

1) $y = 2.(\frac{4}{5})^x$ **is** **exponential function.**

2) $y = 0.5.(5)^x$ **is** **exponential function.**

Match each function with its graph:

1) $y = -(\frac{1}{5})^x$ **2)** $y = 6^x + 3$ **3)** $y = 3.(\frac{1}{4})^x$

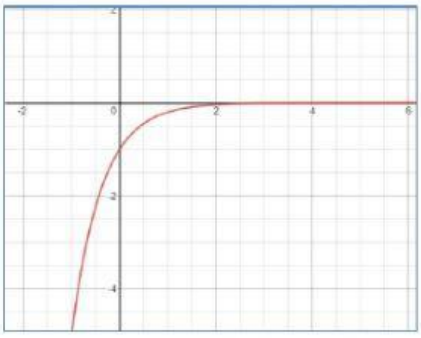

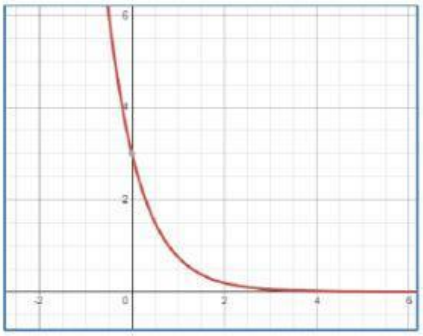

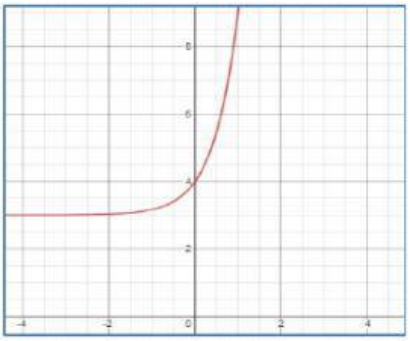

LIVEWORKSHEETS LIVEWORKSHEETS