Mathematics

Tally Marks to 10

Tally Marks to 10 Count the tally marks. Write the number.

___ 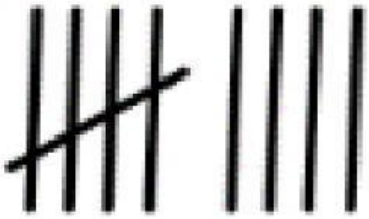	___
___ 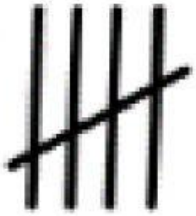	___ 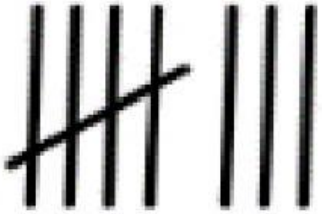
___ 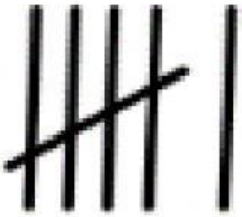	___
___	___ 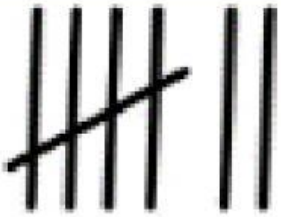
___ 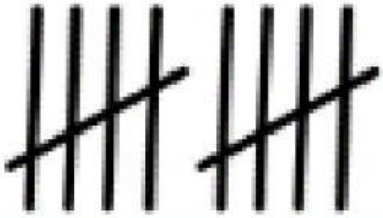	___

LIVEWORKSHEETS