FRAÇÃO

Qual fração representa a parte colorida? Marque a resposta correta.

1. 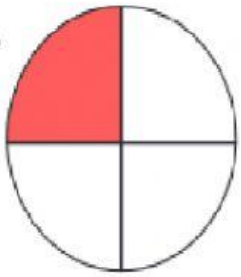

○ $\frac{1}{2}$ ○ $\frac{3}{4}$ ○ $\frac{1}{4}$ ○ $\frac{1}{3}$

2. 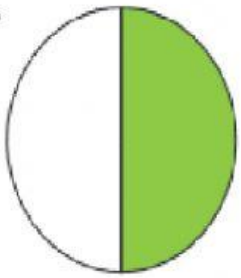

○ $\frac{2}{3}$ ○ $\frac{2}{4}$ ○ $\frac{1}{4}$ ○ $\frac{1}{2}$

3. 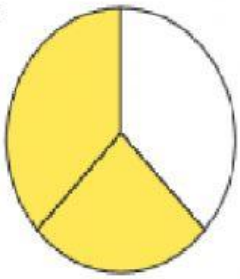

○ $\frac{3}{4}$ ○ $\frac{1}{2}$ ○ $\frac{2}{3}$ ○ $\frac{1}{3}$

4. 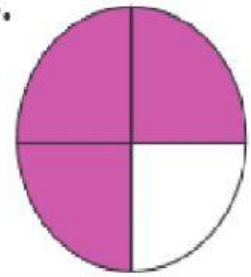

○ $\frac{2}{4}$ ○ $\frac{3}{4}$ ○ $\frac{1}{3}$ ○ $\frac{1}{4}$

5. 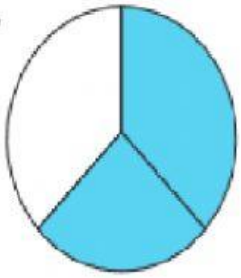

○ $\frac{3}{4}$ ○ $\frac{1}{3}$ ○ $\frac{2}{4}$ ○ $\frac{2}{3}$

LIVEWORKSHEETS

FRAÇÃO

Observe e escreva a fração.

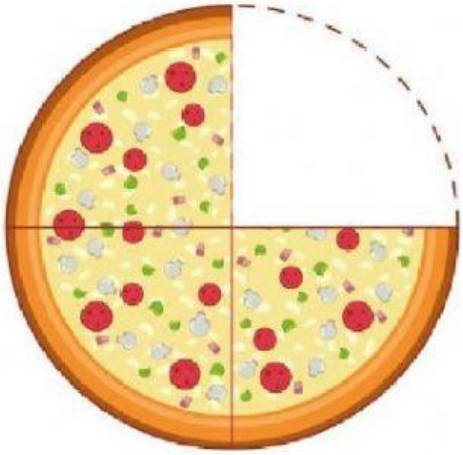

$\frac{3}{4}$

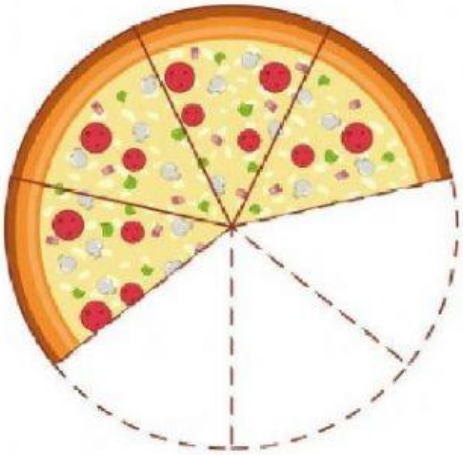

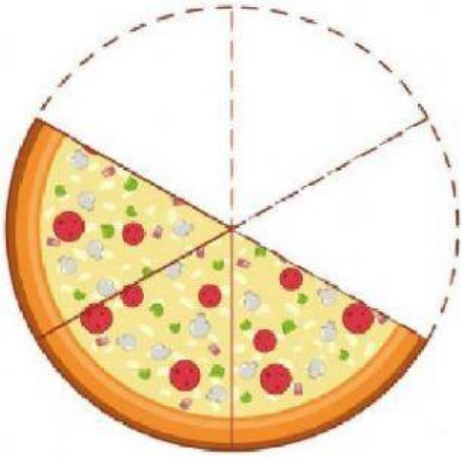

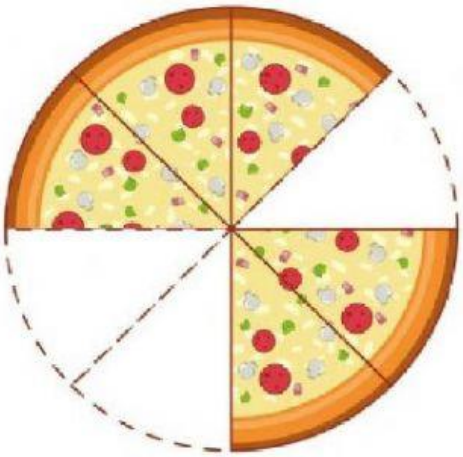

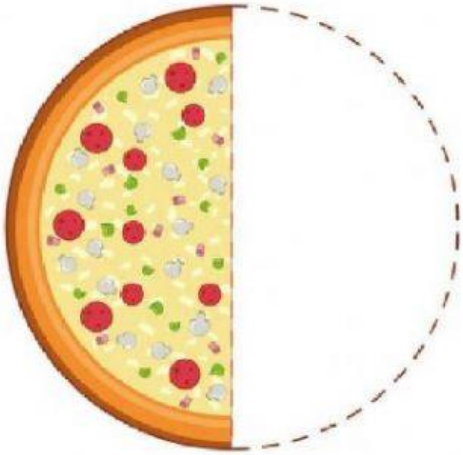

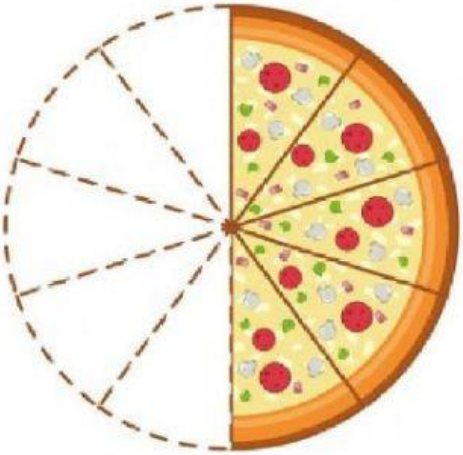

LIVEWORKSHEETS