FITXA RELLOTGE I HORES

1. Completa el rellotge amb els nombres que hi falten.

a)

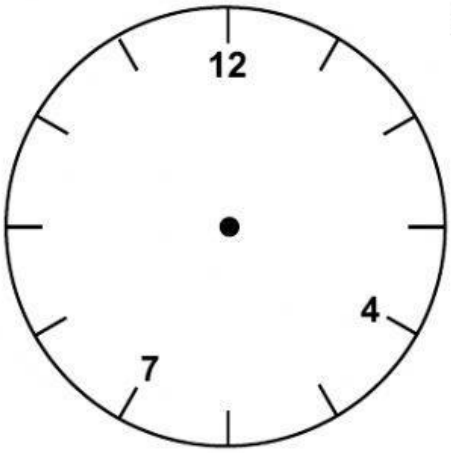

b)

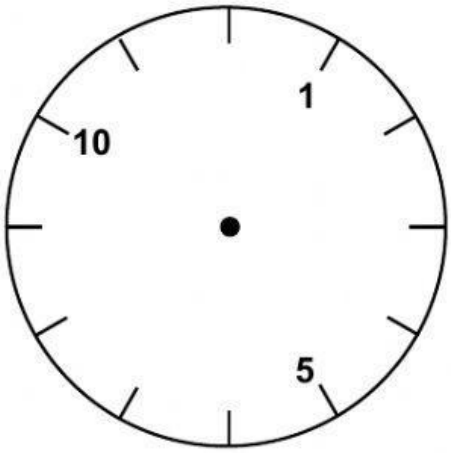

2. Cap a on apunta l'agulla de les hores?

a)



Cap al _____

b)

Cap al _____

3. Escriu l'hora de dues maneres diferents.

a)



_____ en punt

_____ : 00

b)



_____ en punt

_____ : _____

LIVEWORKSHEETS