TAMBAH BERULANG

NAMA : _____

Tulis ayat matematik bagi operasi tambah berulang berikut.

CONTOH

5 + 5 + 5 + 5 = 20

1.

☐ + ☐ + ☐ = ☐

2.

☐ + ☐ + ☐ = ☐

3.

☐ + ☐ + ☐ + ☐ = ☐

4.



☐ + ☐ + ☐ + ☐ = ☐

5.

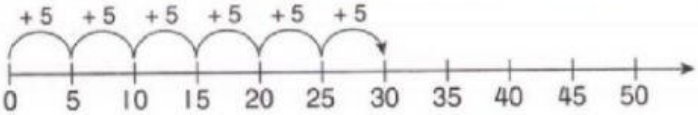

☐ + ☐ + ☐ + ☐ + ☐ + ☐ = ☐

6.

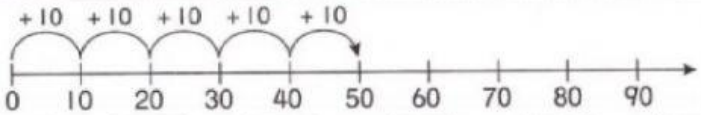

☐ + ☐ + ☐ + ☐ + ☐ = ☐

LIVEWORKSHEETS

Isi tempat kosong

1.

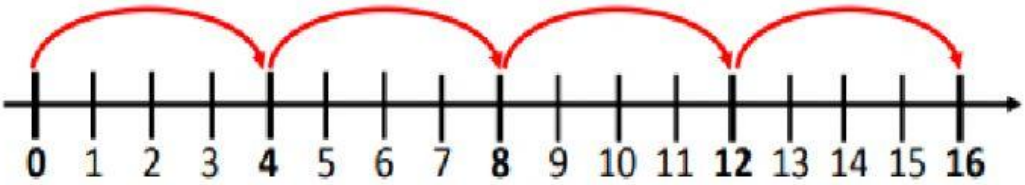

Ada ☐ kumpulan ☐

Jumlah ☐ + ☐ + ☐ + ☐ = ☐

2.

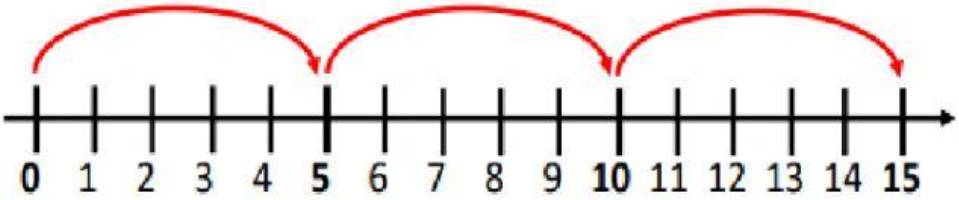

Ada ☐ kumpulan ☐

Jumlah ☐ + ☐ + ☐ = ☐

3.

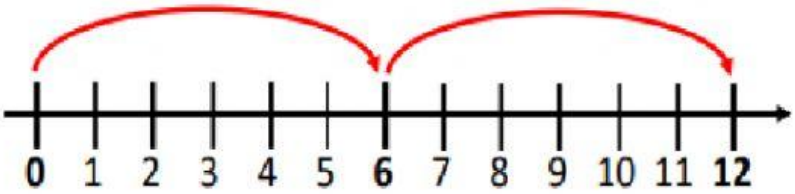

Ada ☐ kumpulan ☐

Jumlah ☐ + ☐ = ☐

LIVEWORKSHEETS